Matematik (Jisim)

Nama : _____ Kelas : _____ Tarikh : _____

A) Tuliskan unit yang sesuai (g atau kg)

B) Nyatakan beratnya dalam kg atau g.

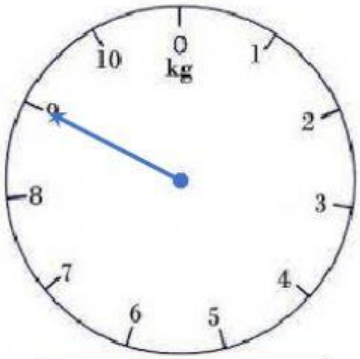

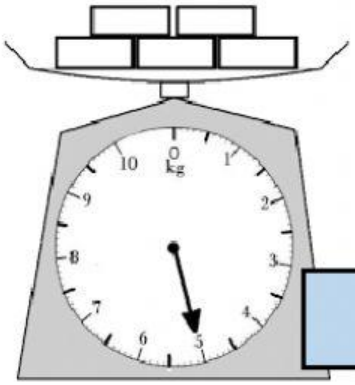

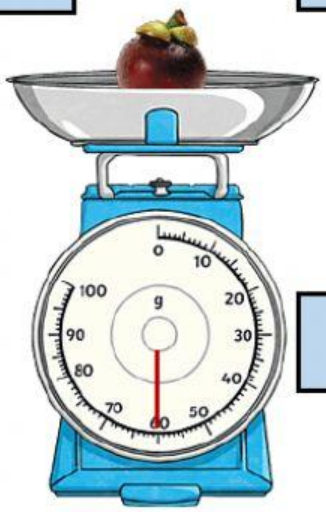

LIVEWORKSHEETS

C) Anggaran jisim (berat) yang sesuai bagi objek di bawah :

lolipop

Ayam segar

LIVEWORKSHEETS