ICM INSAN CENDEKIA MADANI	Assessment Unit 1 and Unit 2	Name :	
		Class :	
		Teacher :	
		Date :	
✓ Individual guided practice ✓ Independent/ fluency practice		Marks: 25	Score:

Read the instruction below and answer all questions!

1 Numbers to 1000

Worksheet 1

Counting in Hundreds, Tens and Ones

1. Count and write the numbers in the boxes.

(a)



☐ hundreds

☐ tens

☐ ones

2. Complete the sentences.

(a) The digit 0 in 306 is in the _____ place.

Its value is _____.

(b) The digit 5 in 985 is in the _____ place.

Its value is _____.

LIVEWORKSHEETS

Worksheet 3

Numbers and Words

1. Match.

(a) 27 • • one hundred and one

(b) 319 • • three hundred and nineteen

(c) 101 • • twenty-seven

Worksheet 2

Place Values

1. Write the numbers in the boxes.

(a) 9 tens 7 ones

(b) 3 hundreds 5 tens 6 ones

LIVEWORKSHEETS

2 More About Numbers

Worksheet 1

Counting On and Counting Back

1

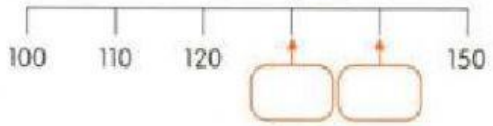

(a) Write the missing numbers in the boxes.

(b) Complete the sentences.

(i) 10 more than 120 is _____.

(ii) 10 less than 150 is _____.

Worksheet 2

Number Line

1 Write the correct letter in each box beside the number.

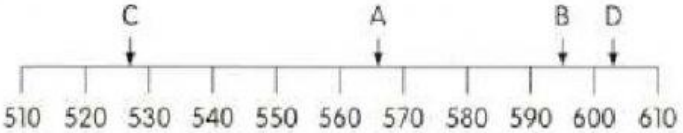

527 ☐ 603 ☐ 595 ☐ 566 ☐

LIVEWORKSHEETS

Worksheet 3

Comparing and Ordering

1. Draw a ring around the smaller number.

(a)

2. Draw a ring around the larger number.

(a)

Worksheet 4

Rounding Numbers

1. Match each number to its value rounded to the nearest ten.

(a)

• • 340

(b)

• • 200

(c)

• • 80

LIVEWORKSHEETS