Name _____ Date _____

Year Group _____

Find the Perimeter of the shapes if each square is 1 square centimeters.

Question 1

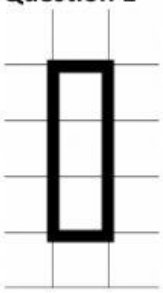

Answer: _____ cm

Question 2

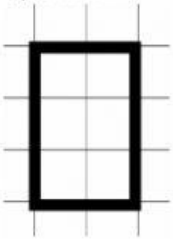

Answer: _____ cm

Question 3

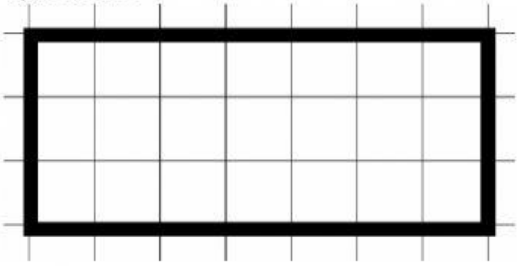

Answer: _____ cm

Question 4



Answer: _____ cm

Question 5

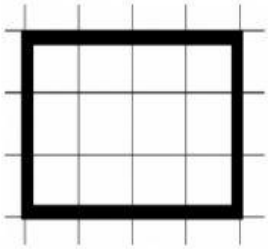

Answer: _____ cm

Question 6

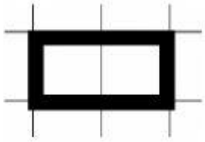

Answer: _____ cm

LIVEWORKSHEETS