1 Numbers to 1000

Worksheet 1

Counting in Hundreds, Tens and Ones

1. Count and write the numbers in the boxes.

(a)



☐ hundreds

☐ tens

☐ ones

(b)



☐ hundreds

☐ tens

☐ ones

LIVEWORKSHEETS

Worksheet 2

Place Values

1. Write the numbers in the boxes.

   (a) 9 tens 7 ones ☐

   (b) 3 hundreds 5 tens 6 ones ☐

   (c) 8 hundreds 2 ones ☐

   (d) 5 hundreds 4 tens ☐

2. Complete the sentences.

   (a) The digit 0 in 306 is in the _____ place.

   Its value is _____.

   (b) The digit 5 in 985 is in the _____ place.

   Its value is _____.

   (c) The digit 6 in 694 is in the _____ place.

   Its value is _____.

   (d) The digit _____ in 925 is in the tens place.

   Its value is _____.

   (e) The digit _____ in 586 is in the hundreds place.

   Its value is _____.

LIVEWORKSHEETS

Worksheet 3

Numbers and Words

1 Match.

(a) 27 • • one hundred and one

(b) 319 • • eight hundred and ninety

(c) 101 • • twenty-seven

(d) 476 • • three hundred and nineteen

(e) 890 • • four hundred and seventy-six

LIVEWORKSHEETS

2 More About Numbers

Worksheet 1

Counting On and Counting Back

1

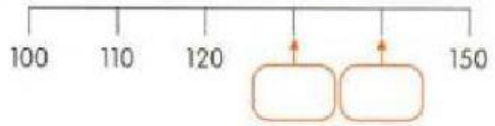

(a) Write the missing numbers in the boxes.

(b) Complete the sentences.

(i) 10 more than 120 is _____.

(ii) 10 less than 150 is _____.

2

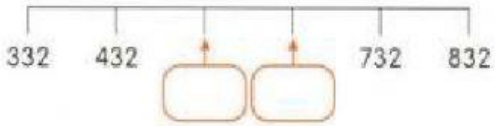

(a) Write the missing numbers in the boxes.

(b) Complete the sentences.

(i) 100 more than 432 is _____.

(ii) 100 less than 732 is _____.

LIVEWORKSHEETS

Worksheet 2

Number Line

1. Write the correct letter in each box beside the number.

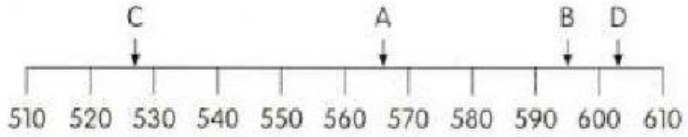

527 ☐ 603 ☐ 595 ☐ 566 ☐

2. Write the numbers in the correct boxes.

578 536 554

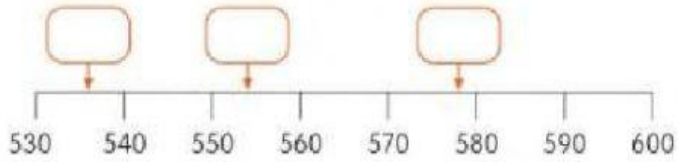

3. Guess the values for A and B.

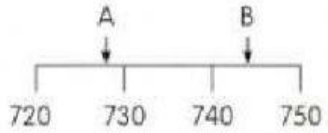

A ☐ B ☐

Compare your answers with your classmate's. Who makes a better guess? What makes you say so?

LIVEWORKSHEETS

Worksheet 3

Comparing and Ordering

1. Draw a ring around the smaller number.

(a)

(b)

2. Draw a ring around the larger number.

(a)

(b)

3. Draw a ring around the smallest number.

(a)

(b)

4. Draw a ring around the largest number.

(a)

(b)

LIVEWORKSHEETS

Worksheet 4

Rounding Numbers

1. Match each number to its value rounded to the nearest ten.

(a) 81 • • 340

(b) 196 • • 200

(c) 344 • • 80

(d) 518 • • 880

(e) 875 • • 520

LIVEWORKSHEETS