1. Escreva o coeficiente de cada termo.

a) $-m$

b) $4xy$

c) $-\frac{2}{5}m$

d) $7ab$

e) $x$

f) $-3d$

2. Simplifique os termos semelhantes.

a) $3x + 4x =$

b) $-3m + 5m =$

c) $x + x + x =$

d) $t - 4t =$

e) $-4m + 5m =$

f) $2y - 5y + y =$

3. Calcule o perímetro de cada figura.

a)

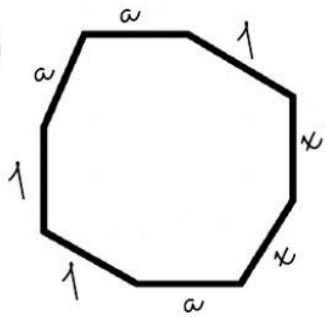


c)

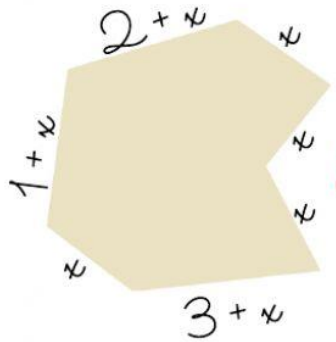


b)

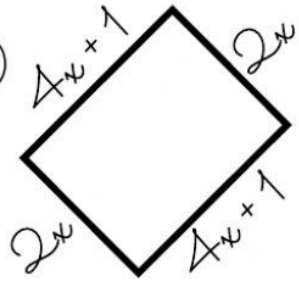


d)

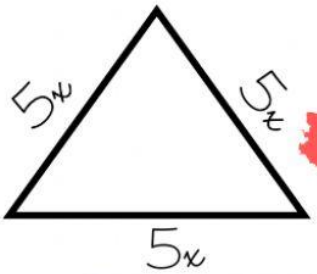


LIVEWORKSHEETS