1. Divida igualmente todos os itens. Faça as contas.

Divida 20 bonecas entre 4 crianças.

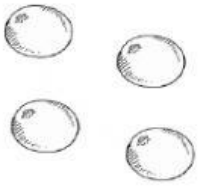

Divida 35 laranjas entre 5 pessoas.



Divida 64 peixes entre 8 aquários.



Divida 50 lápis entre 2 estojos.

8 ⌊4	9 ⌊2	6 ⌊3
-	-	-

LIVEWORKSHEETS

Matemática

x4
1X4 =
2X4 =
3X4 =
4X4 =
5X4 =
6X4 =
7X4 =
8X4 =
9X4 =
10X4 =

58 | 4 _____ 76 | 4 _____ 89 | 4 _____ 15 | 4 _____

65 | 4 _____ 34 | 4 _____ 88 | 4 _____ 46 | 4 _____

a) 22: 2 = _____

22 | 2 _____

c) 14: 2 = _____

14 | 2 _____

b) 32 : 2 = _____

32 | 2 _____

d) 50 : 2 = _____

50 | 2 _____

LIVEWORKSHEETS