Tajuk : Pecahan dan Perpuluhan

Nama : _____ Kelas : _____

Arahan : Tulis pecahan dan perpuluhan bagi kawasan berwarna pada gambarajah

Bil	Gmbarajah	Pecahan	Perpuluhan
1	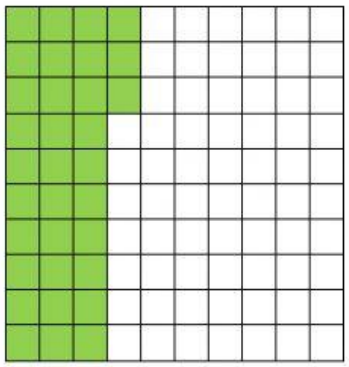	___	
2		___	
3		___	

LIVEWORKSHEETS

4		_____	
5	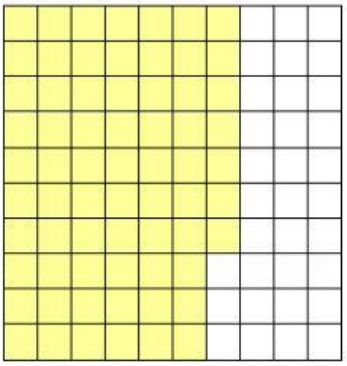	_____	
6		_____	
7	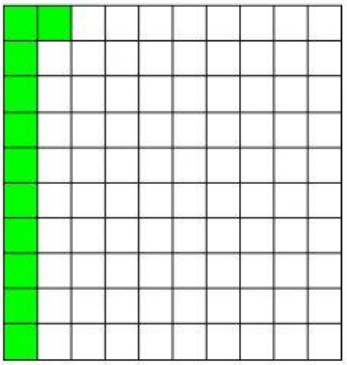	_____	

LIVEWORKSHEETS

8	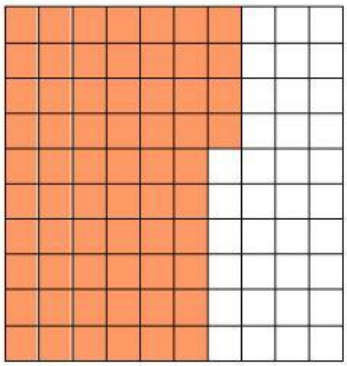	_____	
9		_____	
10		_____	

LIVEWORKSHEETS