Activity 2

1. Complete these.

a

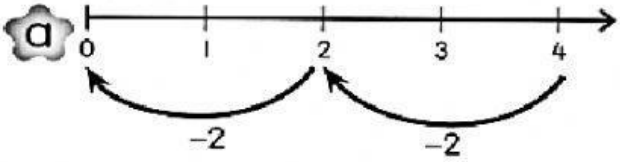

$4 - 2 - \boxed{2} = 0$

b

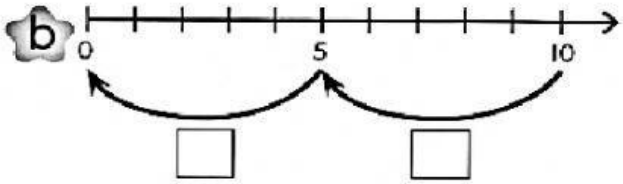

$10 - \square - \square = 0$

c

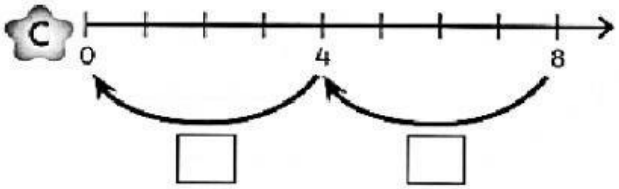

$\square - \square - \square = 0$

d

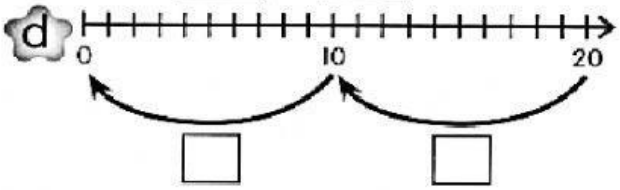

$\square - \square - \square = 0$

2. Complete the number sentences.

a. Ain has 8 packets of lychee drink. She gives 4 packets to Chai. The balance of 4 packets are given to Raj.

$8 - \square - \square = 0$

b. There are 15 cakes on a tray. 5 cakes are put on a plate. 5 cakes are given to a neighbour and the balance are put into a box.

$15 - \square - \square - \square = 0$

c. There are 40 chairs. 10 chairs are sold on Monday. 10 chairs are sold on Tuesday. On Wednesday, 10 chairs are sold. The balance are sold on Thursday.

$\square - \square - \square - \square - \square = 0$

LIVEWORKSHEETS