Ejercicio de Matemáticas

1. Suma contando hacia Adelante. 3 puntos.

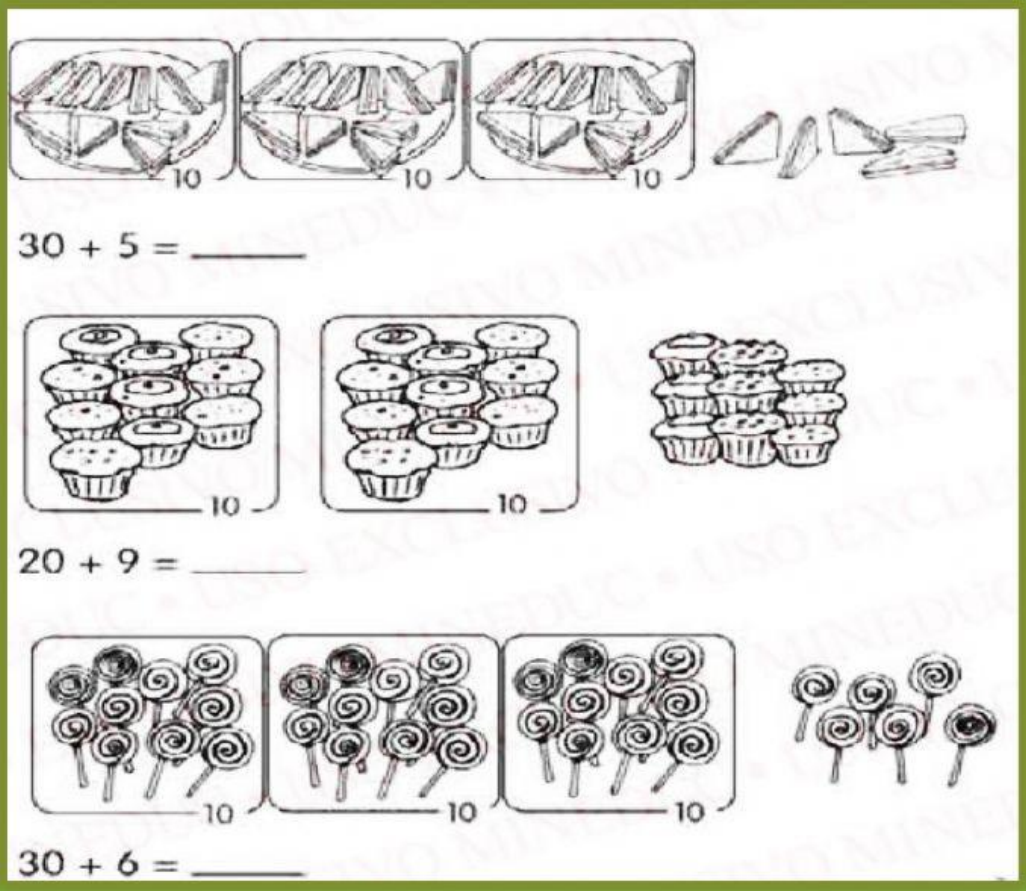

LIVEWORKSHEETS

2. Suma. 7 puntos.

26+ 2= ☐ decenas + ☐ unidades + 2unidades.

= ☐ decenas + ☐ + unidades.

= ☐

3. Suma. 6 puntos

2 8	2 0	3
+ 1	+ 2 0	+ 3 5
☐☐	☐☐	☐☐

¿Cómo se llama este signo +?

LIVEWORKSHEETS

4. Forma la suma de horizontal a vertical y resuelve. 12 puntos

14 + 25 = ☐

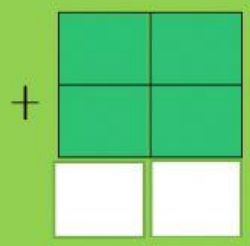

32 + 4 = ☐

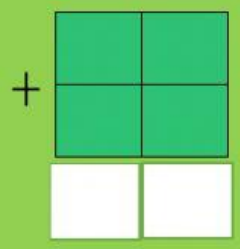



LIVEWORKSHEETS