MATEMATIK TAHUN 3
Pecahan Wajar

Nama : _____ Tarikh : _____

Namakan dan tulis pecahan wajar bagi setiap rajah yang berlorek di bawah.

contoh

= $\frac{1}{4}$ Satu perempat

1)



= $\frac{\square}{\square}$ _____

2)

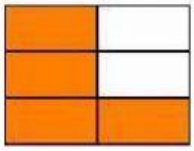

= $\frac{\square}{\square}$ _____

3)

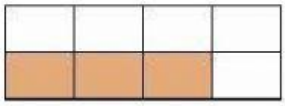

= $\frac{\square}{\square}$ _____

4)

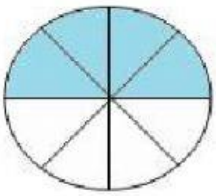

= $\frac{\square}{\square}$ _____

5)

= $\frac{\square}{\square}$ _____

LIVEWORKSHEETS