COLEGIO SAGRADO CORAZÓN
PROF. AUDREY MA. CHAVES MORA
MATEMÁTICA

Práctica
Tema: Fracciones

1. Establezco la relación mayor que, menor que e igual que:

$\frac{9}{12}$	$\frac{3}{12}$	$\frac{13}{27}$	$\frac{26}{27}$
$\frac{21}{24}$	$\frac{12}{24}$	$\frac{17}{42}$	$\frac{7}{42}$
$\frac{18}{30}$	$\frac{18}{30}$	$\frac{33}{66}$	$\frac{23}{66}$

2. Escribo la fracción que corresponde en cada caso:

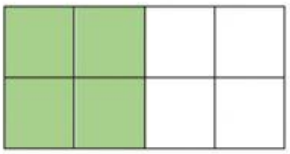

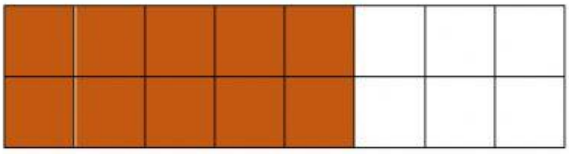

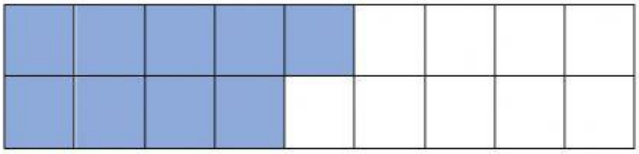

LIVEWORKSHEETS