Nama : Kelas :

1. Nyatakan jenis kemahiran dalam permainan memukul dan memadang berdasarkan gambar rajah di bawah. ▸▸ [redacted]

Membaling bola dengan tangan lurus mengikut arah pusingan jam	Membaling bola dengan tangan lurus melawan arah pusingan jam	Menangkap bola yang melantun	Membaling bola menggunakan balingan bawah

(a)



(c)



(b)



(d)



LIVEWORKSHEETS