MATEMATIK TINGKATAN 1
BAB 10 : PERIMETR DAN LUAS
PERIMETER

SOALAN 1
Lengkapkan ayat di bawah

Perimeter ialah _____ ukuran _____ yang _____ suatu kawasan tertutup.

SOALAN 2

Gambar foto (b)

Saya boleh menggunakan _____ untuk mengukur panjang lengkung.

SOALAN 3

Tentukan perimeter bagi setiap bentuk yang berikut.

(a)

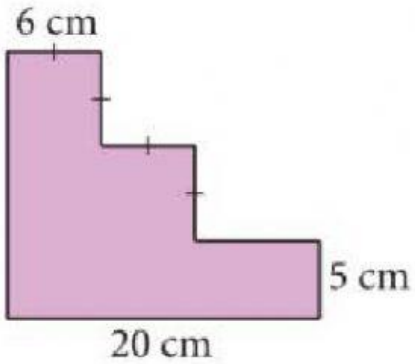

_____ cm

(b)

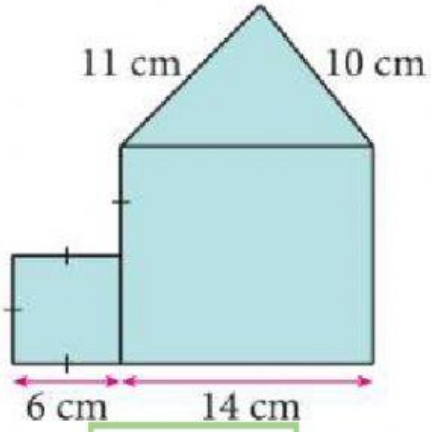

_____ cm

LIVEWORKSHEETS

LUAS

SOALAN 4

Berdasarkan pilihan jawapan, padankan bentuk dengan rumus luas yang betul

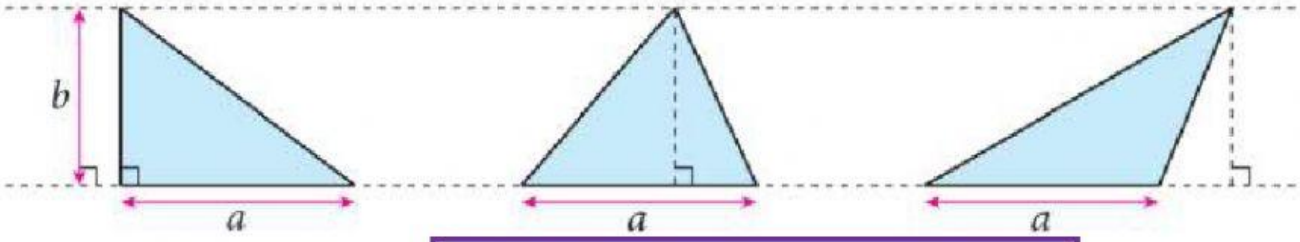

Luas segi tiga =

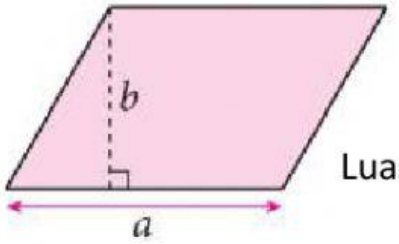

Luas segi empat selari =

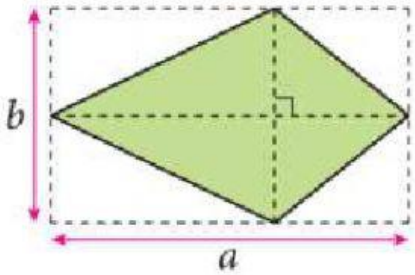

Luas lelayang =

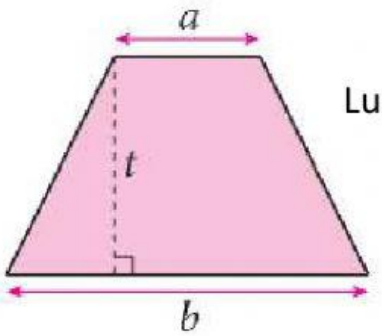

Luas trapezium =

$\frac{1}{2}$ × (hasil tambah dua sisi selari) × tinggi

$\frac{1}{2}$ × panjang tapak × tinggi

panjang tapak × tinggi

$\frac{1}{2}$ × hasil darab panjang dua pepenjuru

LIVEWORKSHEETS

SOALAN 5

Hitung luas setiap bentuk yang berikut.

(a)

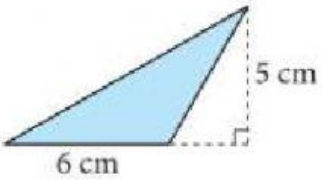

(b)

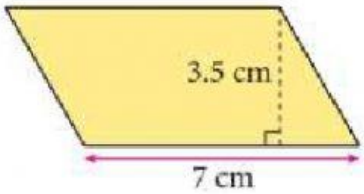

(c)

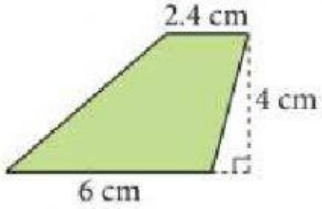

(d)

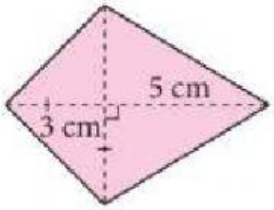

_____ cm _____ cm _____ cm _____ cm

Kerjaya dalam Matematik

Pemaju perumahan menggunakan pengetahuan perimeter dan luas untuk membuat perancangan suatu projek perumahan.

SELAMAT BELAJAR, SEMUA

LIVEWORKSHEETS