PECAHAN

Nama :

Kelas :

Tanggal :

1) _____

2) _____

3) _____

4) _____

5) _____

6) 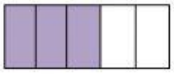 _____

7) _____

8) _____

9) _____

10) _____

Seret pecahan di bawah ini, kemudian lepaskan pada gambar yang tepat!

$\frac{1}{8}$ $\frac{7}{8}$ $\frac{3}{4}$ $\frac{2}{6}$ $\frac{2}{3}$

$\frac{4}{7}$ $\frac{1}{4}$ $\frac{4}{5}$ $\frac{3}{5}$ $\frac{3}{7}$





LIVEWORKSHEETS