ATIVIDADE DE MATEMÁTICA – FRAÇÃO

NOME:

PROFESSORA: SAMARA SOARES

ESCREVA A FRAÇÃO QUE CORRESPONDE A PARTE PINTADA DE CADA FIGURA.

_____

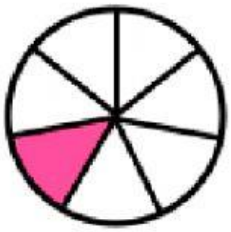

_____

_____

_____

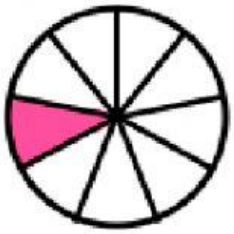

_____

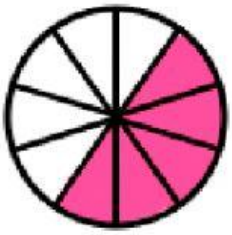

_____

_____

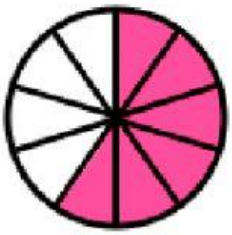

_____

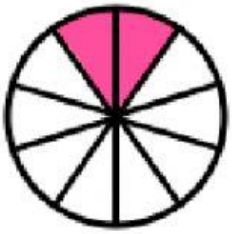

_____

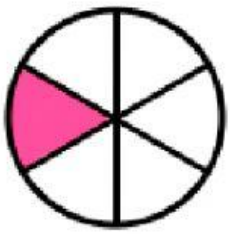

_____

LIVEWORKSHEETS