# LEMBAR KERJA PESERTA DIDIK

# (LKPD)

MATA PELAJARAN: MATEMATIKA TEMA 1

KELAS 1

Oleh: KASNIATUN, S.Pd. // SDN PEGADUNGAN 04 PAGI

Nama: _____

Perhatikan tayangan video berikut ini sebelum kalian mengerjakan latihan soal!

ESSAY!

Tuliskan nama bilangan yang sesuai dengan gambar!

1.



Jawaban:

2.



Jawaban:

3.



Jawaban:

LIVEWORKSHEETS

4.



Jawaban:

5.

Jawaban:

6.

Jawaban:

7.

Jawaban:

8.

Jawaban:

9.



Jawaban:

10.

Jawaban:

LIVEWORKSHEETS