KENDRIYA VIDYALAYA AFS WADSAR

WORK SHEET

CLASS – V SUB - MATHS TOPIC : How Many Squares?

Que1 Write the area(in square cm) of shapes below.

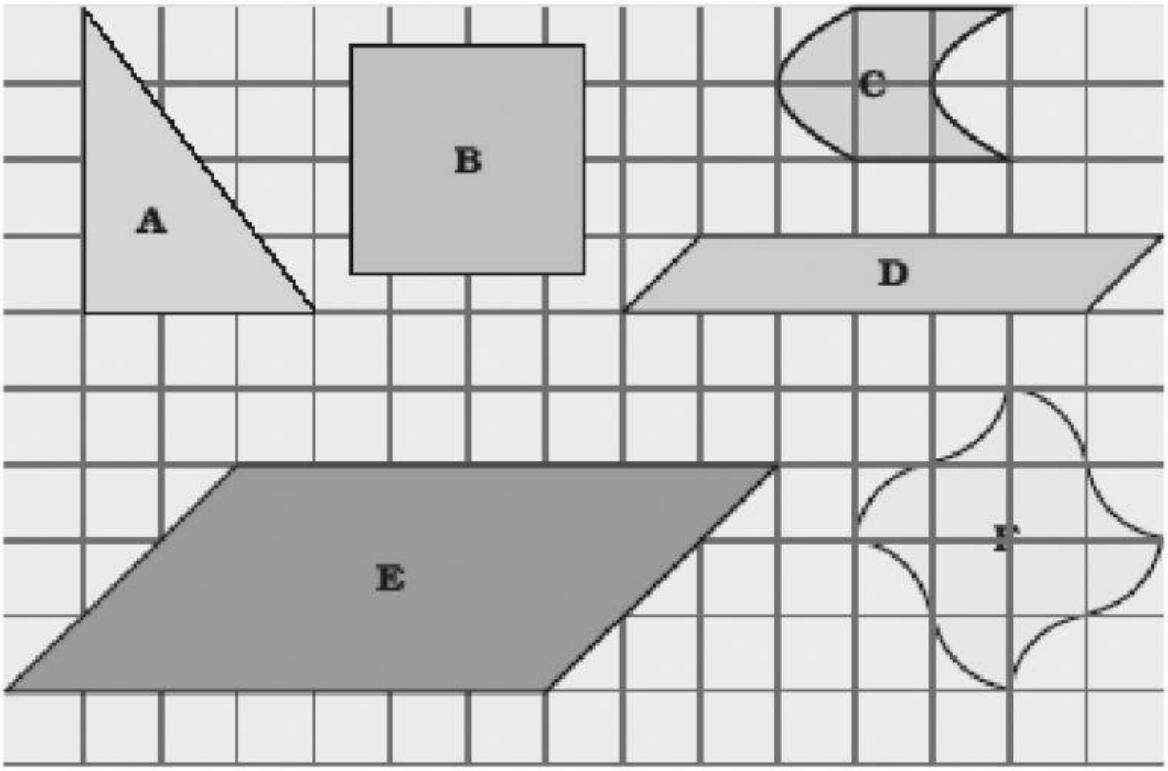

A. _____ Sq. Cm B. _____ Sq. Cm C. _____ Sq. Cm

D. _____ Sq. Cm E. _____ Sq. Cm F. _____ Sq. Cm

Que 2 Fill in the missing fraction parts.

a.

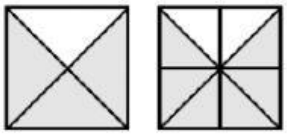

$\frac{3}{4} = \frac{\quad}{8}$

b.

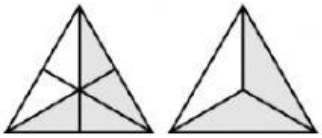

$\frac{4}{6} = \frac{\quad}{3}$

c.

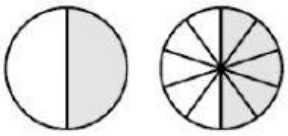

$\frac{1}{2} = \frac{\quad}{10}$

LIVEWORKSHEETS