(A) Using the words given, label the parts of plant. LS6.1.1 PL1

Leaf | Stem | Root | Fruit | Flower

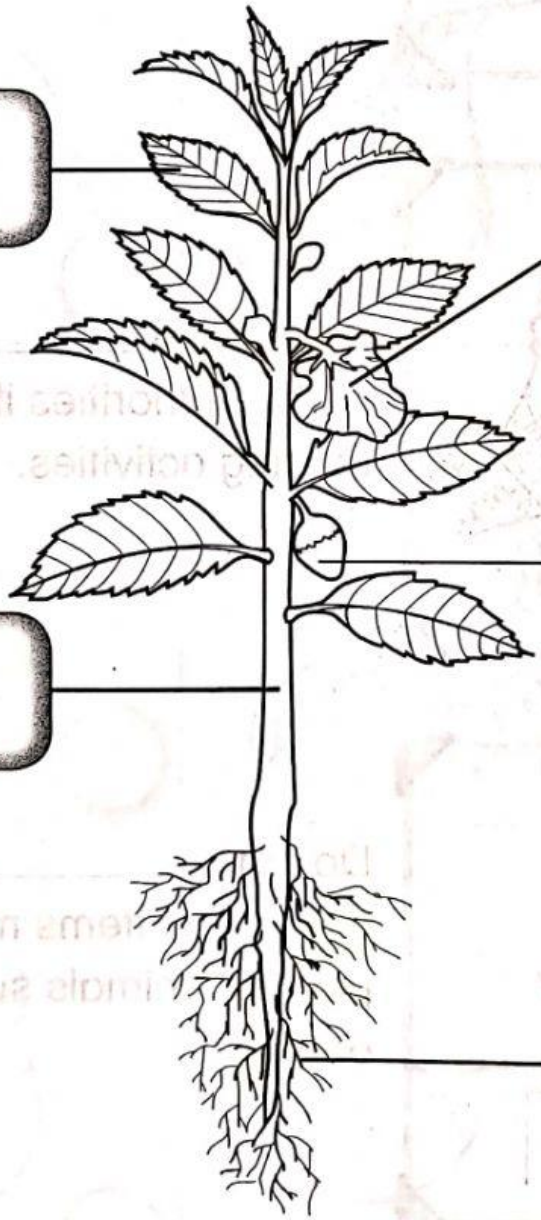

1 _____

2 _____

3 _____

4 _____

5 _____

Scanned with CamScanner
LIVEWORKSHEETS

© Tick (✓) the plants with the given characteristic. LS6.1.3 PL3

1 Parallel-veined leaf



2 Non-flowering

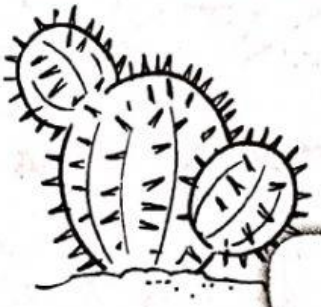

3 Non-woody stem

Scanned with CamScanner
LIVEWORKSHEETS

D Classify the following plants correctly. LS6.1.4 PL4



Seaweed

Papaya tree

Mushroom

Hibiscus plant

Fern

Balsam plant

1 Flowering plants	2 Non-flowering plants

Scanned with CamScanner
LIVEWORKSHEETS