Lembar Kerja Peserta Didik (LKPD)
Arti Pecahan

Nama :

Kelas : Hari,tgl :

Perhatikan video berikut !

$\frac{3}{9}$	$\frac{3}{6}$	$\frac{8}{9}$
$\frac{4}{5}$	$\frac{3}{4}$	$\frac{1}{10}$
$\frac{1}{3}$	$\frac{4}{8}$	$\frac{5}{7}$

LIVEWORKSHEETS

$\frac{5}{9}$ $\frac{3}{3}$ $\frac{1}{2}$

Letakkan gambar peacahan dibawah ini kedalam kotak diatas yang tepat !

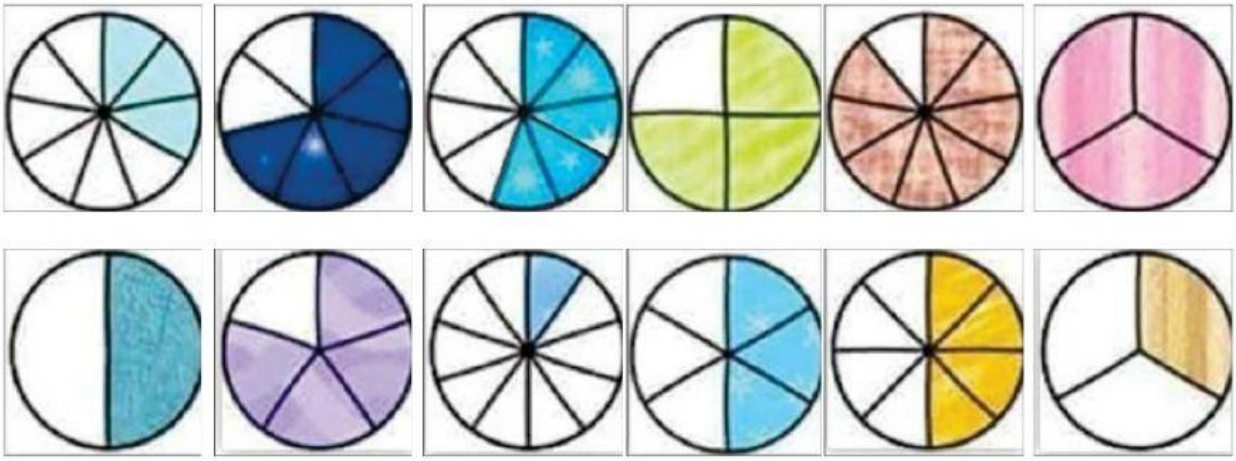

LIVEWORKSHEETS

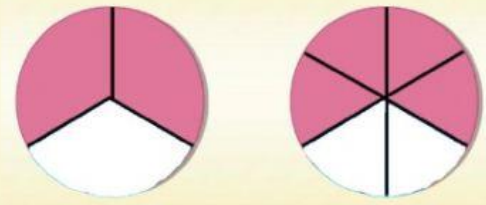

$\frac{2}{3}$ $\frac{4}{6}$

Kerjakan soal dibawah ini sesuai dengan contoh diatas !

1)	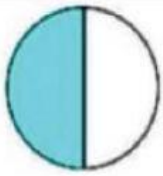	$\frac{\square}{\square} = \frac{\square}{\square}$	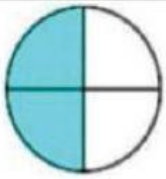	6)		$\frac{\square}{\square} = \frac{\square}{\square}$	
2)		$\frac{\square}{\square} = \frac{\square}{\square}$		7)		$\frac{\square}{\square} = \frac{\square}{\square}$	
3)		$\frac{\square}{\square} = \frac{\square}{\square}$		8)		$\frac{\square}{\square} = \frac{\square}{\square}$	
4)	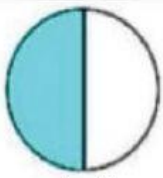	$\frac{\square}{\square} = \frac{\square}{\square}$		9)		$\frac{\square}{\square} = \frac{\square}{\square}$	
5)		$\frac{\square}{\square} = \frac{\square}{\square}$	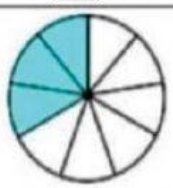	10)		$\frac{\square}{\square} = \frac{\square}{\square}$	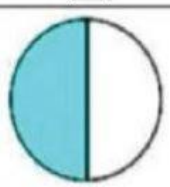

LIVEWORKSHEETS