Nyatakan petak yang berwarna dalam bentuk perpuluhan seperti contoh dijawapan nombor 1

1) 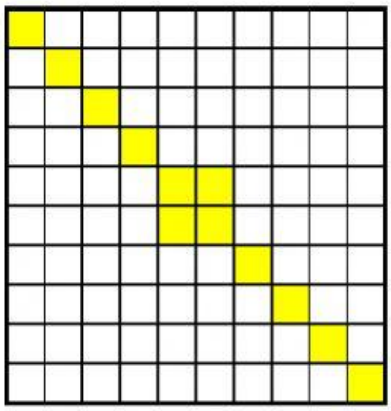

= 0 . 1 2

= Sifar perpuluhan satu dua

2) 

= _____

= _____

3) 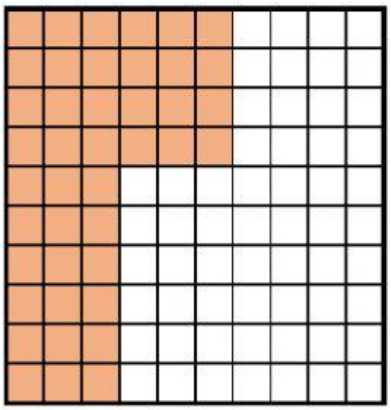

= _____

= _____

4) 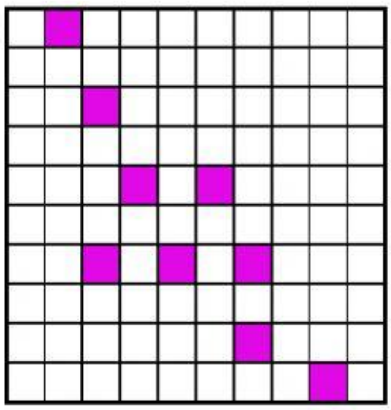

= _____

= _____

5) 

= _____

= _____

6) 

= _____

= _____

7) 

= _____

= _____

8) 

= _____

= _____

9) 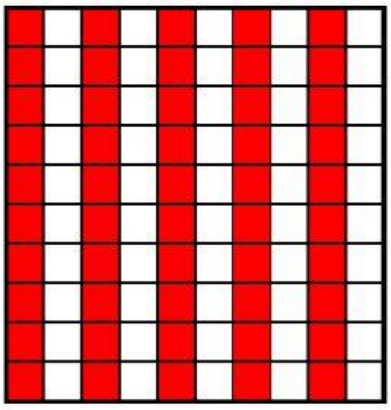

= _____

= _____

** ***SEBELUM TEKAN "FINISH" SEMAK DULU YA.....***

LIVEWORKSHEETS