Penilaian Tahap Penguasaan 8.2c

1. Label kedudukan fulkrum, beban dan daya bagi tuas-tuas di bawah. TP 1
Label the position of the fulcrum, load and effort for the levers below.

(a)

(b)

2. Padankan kelas tuas yang berikut kepada contoh aplikasi yang sesuai. TP 4 KBAT Menganalisis
Match the following class of lever to its suitable example of application.

Kelas tuas *Classification of levers*	Contoh aplikasi *Example of application*
(a)	(i)
(b) 	(ii)
(c) 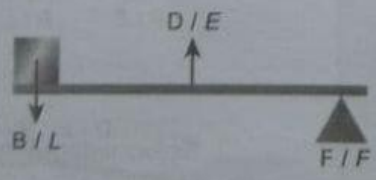	(iii) 

LIVEWORKSHEETS