Study the picture below of 1 goose and 2 duckling. Then decide in the following pictures which is heavier, lighter or having the same weight.





lighter
heavier
same weight

lighter
heavier
same weight



lighter
heavier
same weight

lighter
heavier
same weight



lighter
heavier
same weight

lighter
heavier
same weight



lighter
heavier
same weight

lighter
heavier
same weight

LIVEWORKSHEETS