DL DAV Model School

ND Block , Pitampura, Delhi- 34

CAMBRIDGE
International Examinations
Cambridge International School

BRITISH COUNCIL
INTERNATIONAL SCHOOL AWARD
2019–22

Class III
Mathematics Revision sheet

Q1. Answer all the following questions:

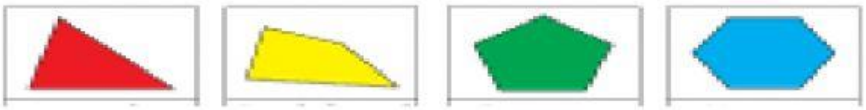

A B C D

E

a. Choose the shape that is hexagon in the above picture?

Ans: _____

b. Write the name of shape E? How many right angles do shape A enclose in the figure?

Ans: _____, _____

c. Choose the shape that is a quadrilateral from the figures given:

Ans: _____

d. Choose the shapes that look regular polygon:

Ans: _____, _____

LIVEWORKSHEETS

Q2. Complete the following:

Round the number 494 to nearest 10 -_____

Round the number 494 to nearest 100-_____

Q3. Write the names of the shapes and put them as regular or irregular polygon:

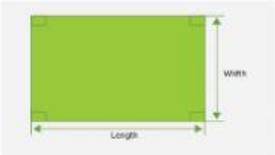

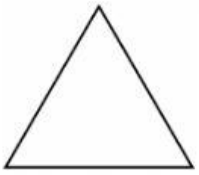

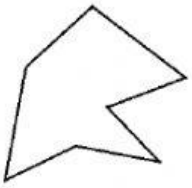

A _____ B _____ C_____ D_____

Regular Polygon	Irregular Polygon

Q4. a)Choose the figure that shows regular tessellation and semi tessellation. Write the correct option in the boxes:



Figure A



Figure B

LIVEWORKSHEETS

Ans: Regular _____ Semi _____

b) Choose the option of the shape that shows regular tessellation:

1) **Regular pentagon**
2) **Regular heptagon**
3) **square**

Ans: _____

Q5. Work out the area of the compound shape given below and write the answer in the box below:

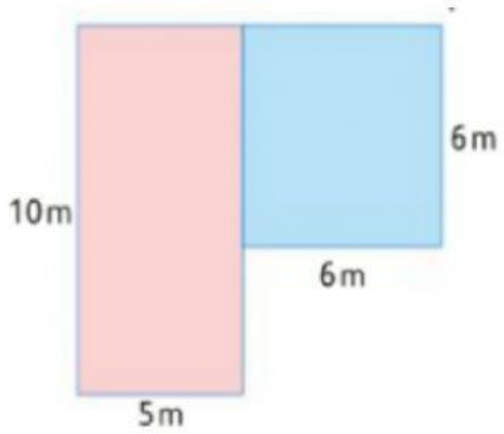

Ans: _____ m^2

Q6. A origami paper is of square shape has an area of $36cm^2$ **Choose the correct option that could be one of the dimension pairs of the above rectangle.**

a) **9cm,4cm**
b) **6cm, 6cm**

LIVEWORKSHEETS

c) 8cm, 4cm

Ans: ____

Q7. Find the area of the irregular shape on square grid of 1cm^2 .Estimate the total area occupied by the figure

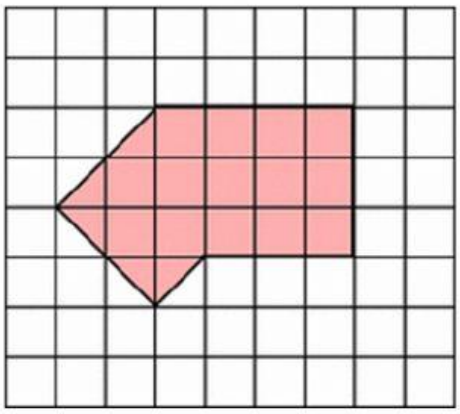

Ans: _____cm^2

Q7. A origami paper is of square shape has an area of 36cm^2 Choose the correct option that could be one of the dimension pairs of the above rectangle.

d) 9cm,4cm
e) 6cm, 6cm
f) 8cm, 4cm

Ans: ____

LIVEWORKSHEETS