លំហាត់អនុវត្តន៍

I.ចូរបំពេញផលបូកខាងក្រោយអោយបានត្រឹមត្រូវ។

546 +436	438 +522	312 +349
724 +137	239 +436	523 +267
155 +238	447 +327	262 +239

LIVEWORKSHEETS

II.ចូរបំពេញផលគុណខាងក្រោយអោយបានត្រឹមត្រូវ។

7 x 2 = ____	6 x 7 = ____
6 x 4 = ____	7 x 3 = ____
7 x 8 = ____	6 x 6 = ____
6 x 5 = ____	7 x 5 = ____
7 x 4 = ____	6 x 1 = ____
6 x 8 = ____	7 x 7 = ____
7 x 6 = ____	6 x 8 = ____
6 x 2 = ____	7 x 9 = ____
7 x 6 = ____	6 x 4 = ____
6 x 9 = ____	7 x 5 = ____

LIVEWORKSHEETS

III. ចូរជ្រើសរើសចម្លើយខាងក្រោមអោយបានត្រឹមត្រូវ។

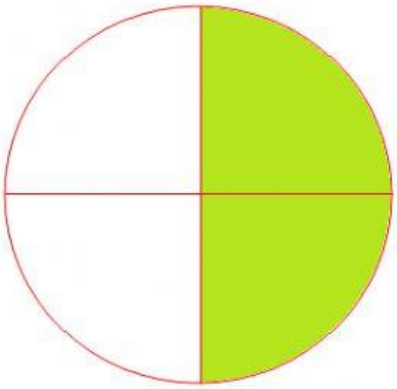

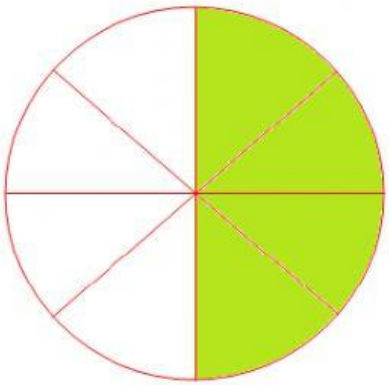

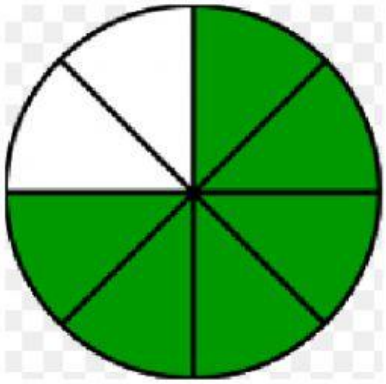

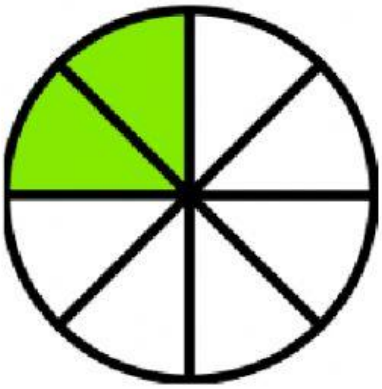

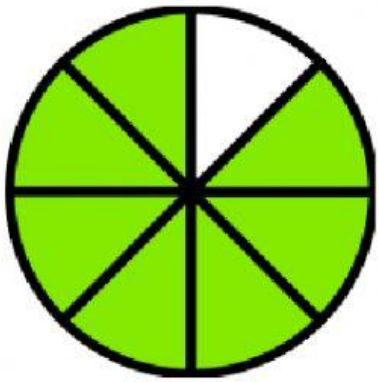

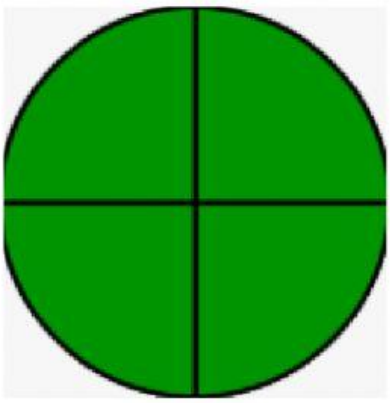

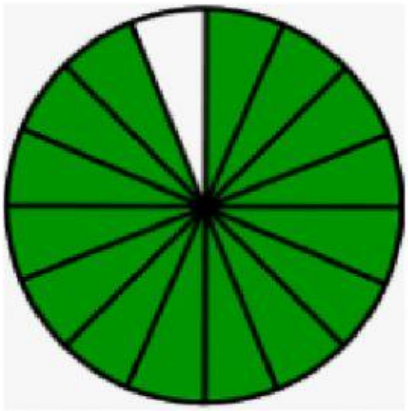

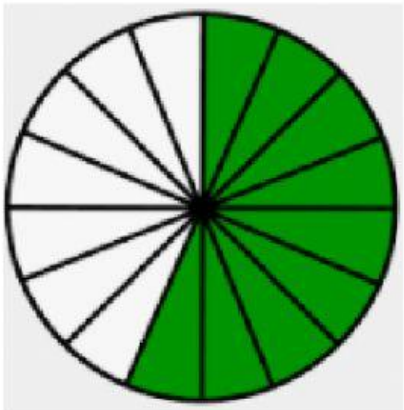

LIVEWORKSHEETS

IV.ចំណេះទ

១. ម៉ែងឆាយមានសៀវភៅ26ក្បាល។ បញ្ញារ័ត្នមានសៀវភៅតិចជាងម៉ែងឆាយ5ក្បាល។ តើបញ្ញារ័ត្នមានសៀវភៅប៉ុន្មានក្បាល?

—　　=

ដូចនេះបញ្ញារ័ត្នមានសៀវភៅចំនួនគឺ　　ក្បាល។

២. មុន្នីរក្សមានខ្មៅដៃ30ដើម។ សុខនាថមានខ្មៅដៃច្រើនជាងមុន្នីរក្សចំនួន6ដើម។ តើសុខនាថមានខ្មៅដៃប៉ុន្មានដើម?

—　　=

ដូចនេះសុខនាថមានខ្មៅដៃចំនួនគឺ　　ដើម។

LIVEWORKSHEETS