Assumption College Ubonratchathani
English for Science 1

Name _____ Class_____ No_____

Laboratory Apparatus

Instruction: *Identify the following laboratory apparatus*

1.
2.
3.
4.
5.
6.
7. 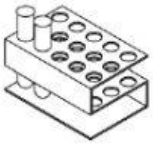
8.

Bunsen burner
beakers
test tube
mortar and pestle
test tube holder
tripod stand
funnel
round bottom flask
conical flask
flat bottom flask
adjustable stand
spatula
measuring cylinder
pipette
test tube rack
burette

9. 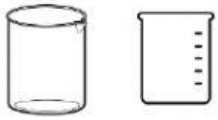
10.
11.
12. 
13. 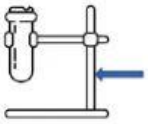
14.
15.
16.

LIVEWORKSHEETS