Kehidupan Manusia Zaman Prasejarah

Nama : _____

Bahagian A : Tuliskkan nama zaman prasejarah berdasarkan gambar .

Zaman Mesolitik

Zaman Neolitik

Zaman Paleolitik

Zaman Logam









LIVEWORKSHEETS

Bahagian B : Suaikan kegiatan ekonomi zaman prasejarah berdasarkan aktiviti mereka pada zaman itu .

Zaman Mesolitik	**Aktiviti perdagangan melalui pelayaran .**
Zaman Neolitik	**Aktiviti menangkap ikan .**
Zaman Logam	**Mengutip hasil hutan dan memburu haiwan ..**
Zaman Paleolitik	**Aktiviti perdagangan secara tukar barang .**

LIVEWORKSHEETS