EQUIVALENCIAS USANDO LA BALANZA ALGEBRAICA

1. Ayuda a Pedro a relacionar cada balanza con una igualdad, luego resolvamos las igualdades y respondamos ¿Cuántos cubos hay en cada bolsa?

a) PRIMER PASO:

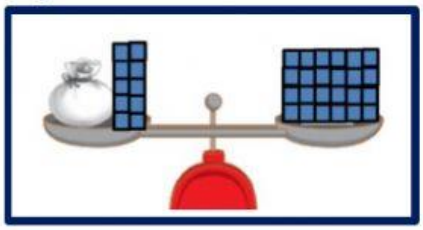

+ 8 = 15

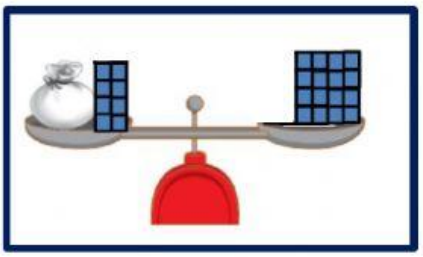

+ 10 = 24

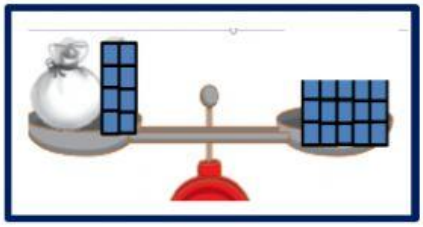

+ 8 = 16

b) SEGUNDO PASO:

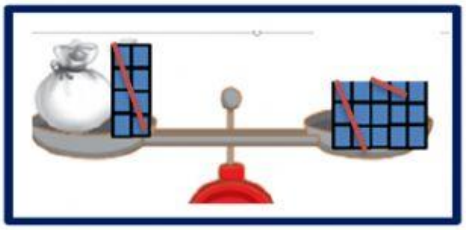

+ 10 - 10 = 24 - 10

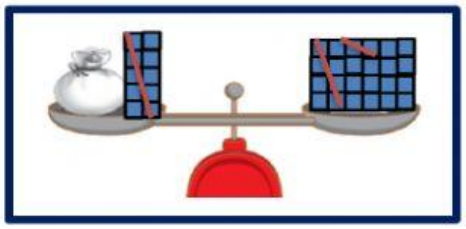

+ 8 - 8 = 16 - 8

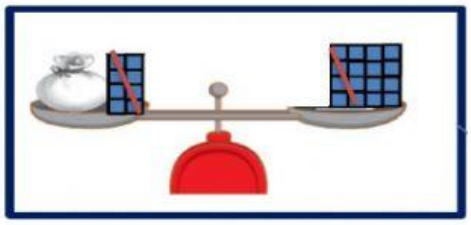

+ 8 – 8 = 15 - 8

LIVEWORKSHEETS

C) TERCER PASO:

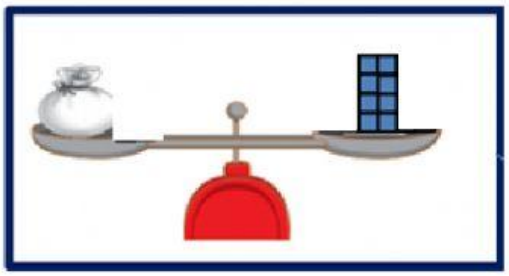

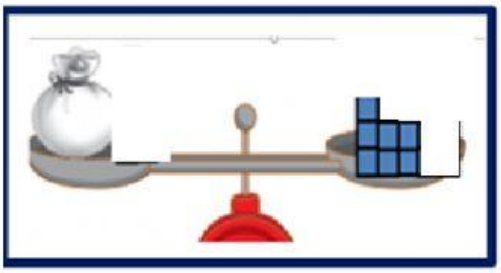

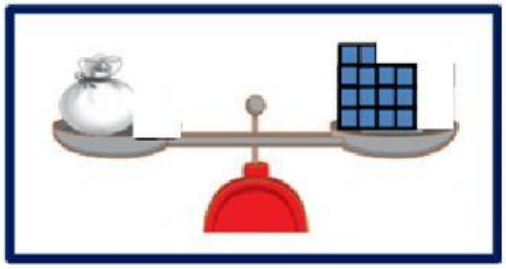

LIVEWORKSHEETS