¡FORMEMOS DECENAS!

10 unidades = 1 decena

D	U
1	0

Cuenta, completa y escribe los números en la tabla de valores.

_____ y _____

D	U

_____ y _____

D	U

_____ y _____

D	U

_____ y _____

D	U

_____ y _____

D	U

_____ y _____

D	U

_____ y _____

D	U

_____ y _____

D	U

Registra el número representado cada tabla de valores.

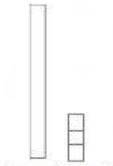

D	U

D	U

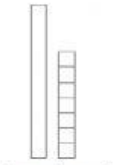

D	U

D	U

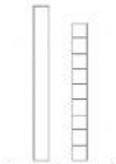

D	U

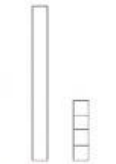

D	U

D	U

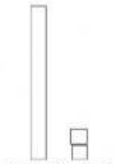

D	U

D	U

D	U

CLARA TORRES MELO
Educadora Diferencial_Chile

LIVEWORKSHEETS