RUANG (TAHUN 6)

NAMA : _____

KELAS : _____

Tonton video berikut berulangkali untuk memahami topik yang dipelajari

Disediakan Cikgu Normizah Amir Hamzah

LIVEWORKSHEETS

Taip jawapan di ruangan yang disediakan

A. Jawab semua soalan di bawah.

1. Ini sudut _____.

2. Berapakah nilai sudut ini?

_____

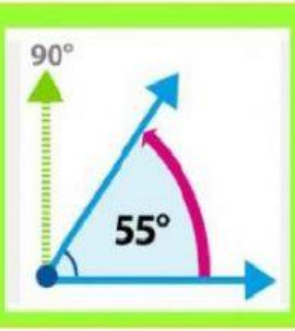

3 Sudut tegak mestilah

berukuran tepat _____.

4. Nama lain bagi sudut tegak

ialah _____.

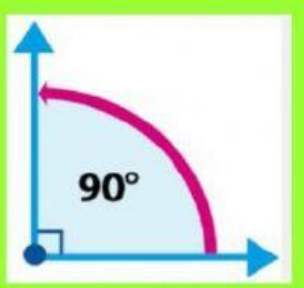

5. Ini sudut _____.

6. Ciri sudut ini ialah

Ukuran sudut melebihi _____.

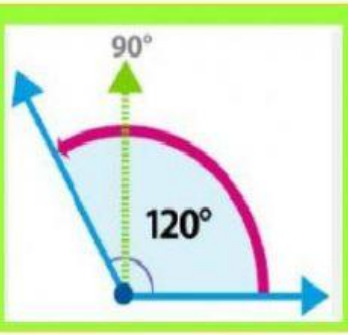

7. Nama alat untuk mengukur sudut

ialah _____

8. Apakah kegunaan alat ini?

_____

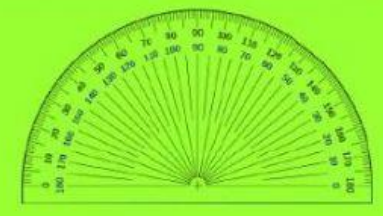

LIVEWORKSHEETS

Taip jawapan di ruangan yang disediakan

B. Nyatakan bacaan sudut di bawah.

1. Sudut DEF = _____

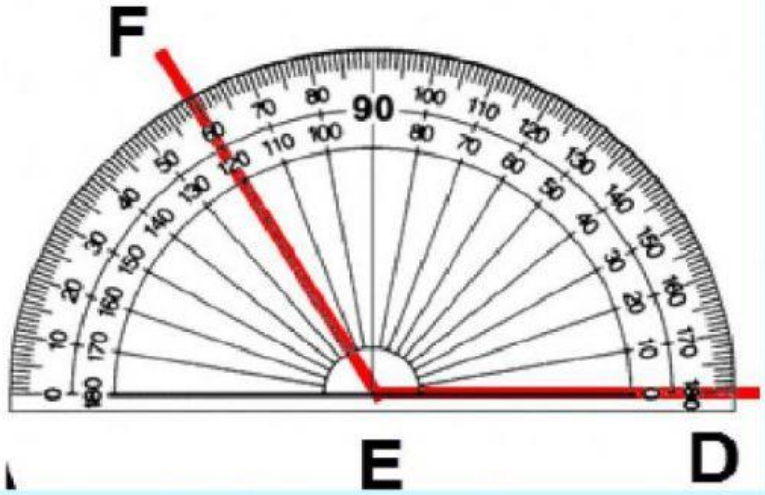

2. Sudut ABC = _____

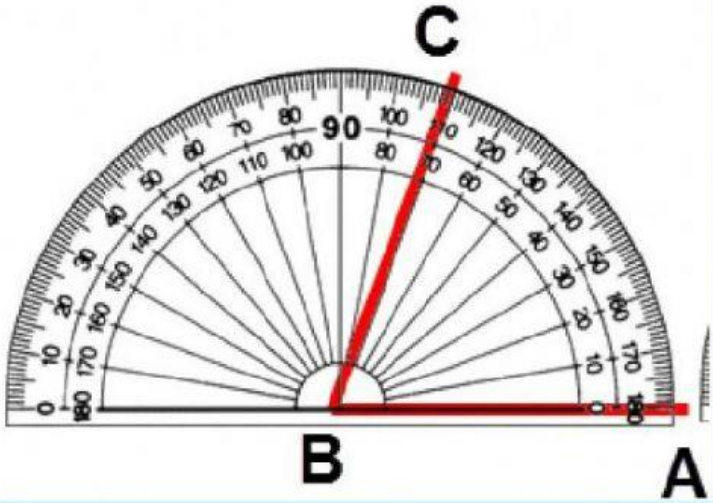

LIVEWORKSHEETS

Taip jawapan di ruangan yang disediakan

3. Sudut GHI = _____

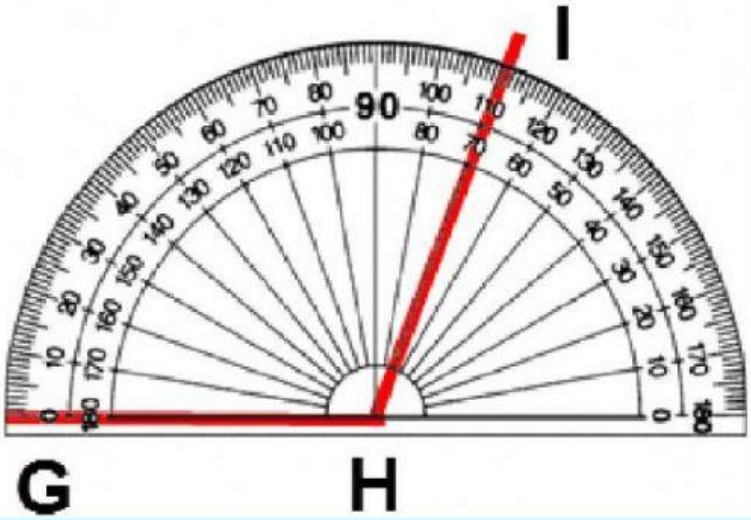

4. Sudut JKL = _____

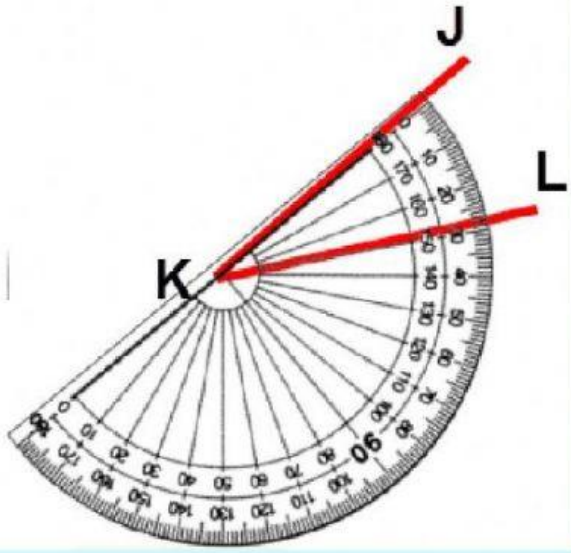

LIVEWORKSHEETS

Taip jawapan di ruangan yang disediakan

5. Sudut MNO = _____

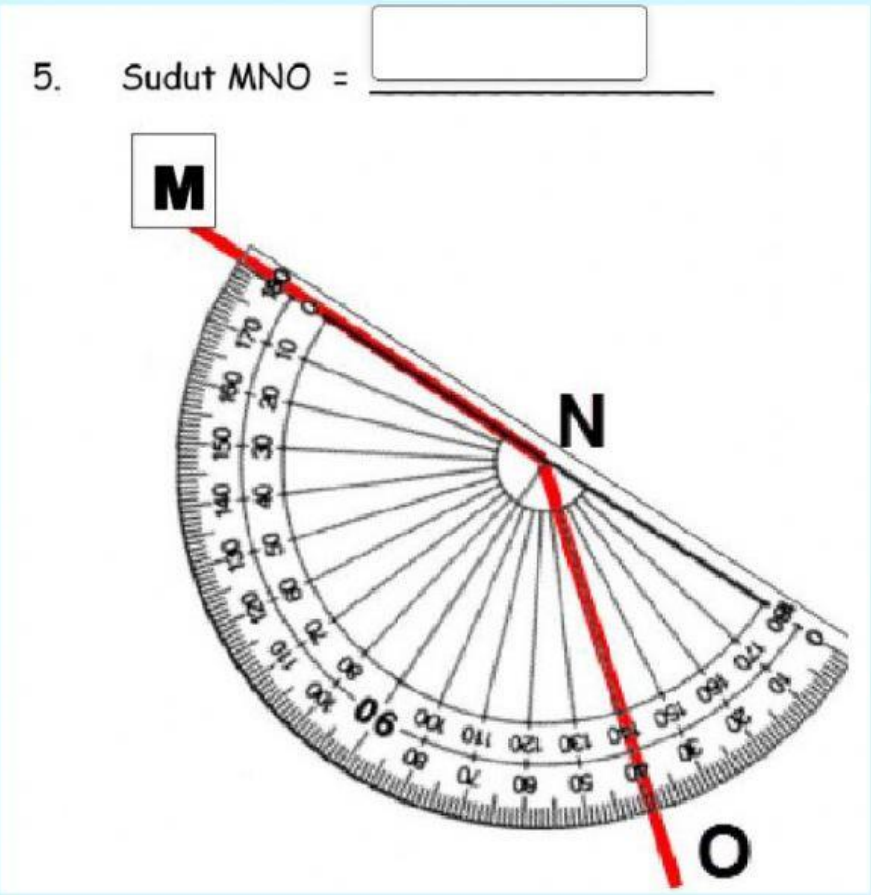

LIVEWORKSHEETS