Nama : ..... Kelas : .....

Kenal Peratus

1. Isi tempat kosong dengan betul.

a)

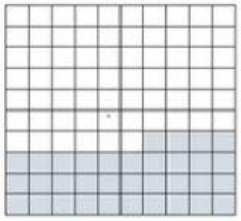

34 daripada 100 ialah $\frac{34}{100}$.

$\frac{34}{100}$ dalam peratus ditulis **34%** .

Kita sebut **tiga puluh empat peratus** .

b)

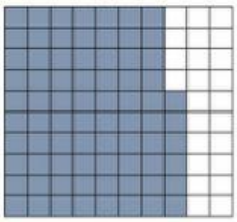

☐ daripada 100 ialah $\frac{☐}{100}$.

$\frac{☐}{100}$ dalam peratus ditulis ☐%.

Kita sebut ☐ .

c)

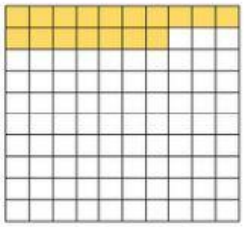

☐ daripada 100 ialah $\frac{☐}{100}$.

$\frac{☐}{100}$ dalam perpuluhan ditulis ☐ .

Kita sebut ☐ .

2. Perkaitan antara pecahan, perpuluhan dan peratus.

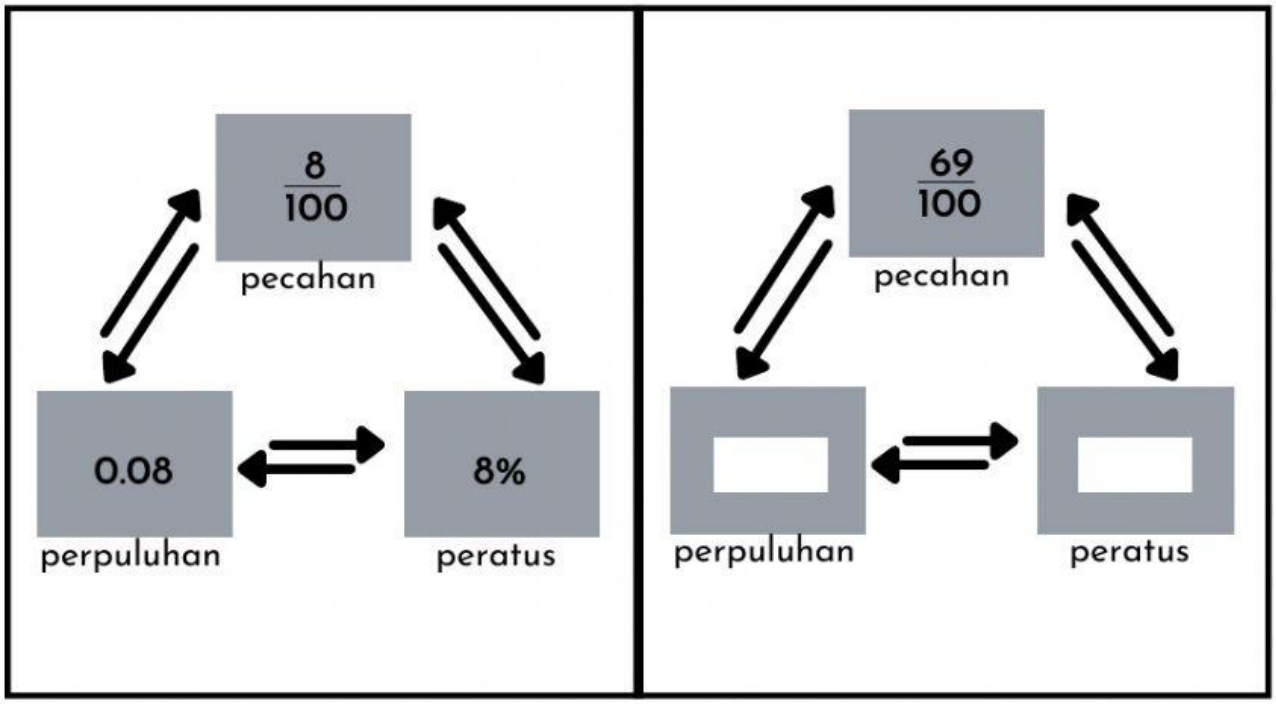

LIVEWORKSHEETS