PECAHAN SETARA / EQUIVALENT FRACTIONS

Dua pecahan yang setara bermaksud pecahan tersebut adalah sama atau menunjukkan nilai yang sama. Tuliskan pecahan setara bagi kawasan berlorek.

If two fractions are equivalent it means they are equal, or represent the same amount. State the equivalent fractions for the shaded region.

NAMA/NAME:_____ KELAS/CLASS:_____

1)	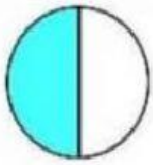	$\frac{1}{2}$ =	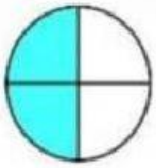	$\frac{\quad}{4}$	6)	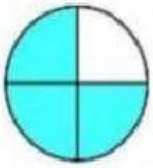	$\frac{\quad}{4}$ =	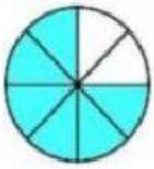	$\frac{\quad}{8}$
2)		$\frac{1}{3}$ =		$\frac{\quad}{6}$	7)	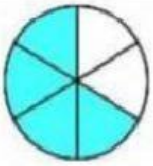	$\frac{\quad}{6}$ =		$\frac{\quad}{3}$
3)	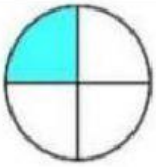	$\frac{1}{4}$ =	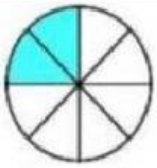	$\frac{\quad}{8}$	8)	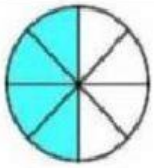	$\frac{\quad}{8}$ =	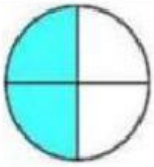	$\frac{\quad}{4}$
4)	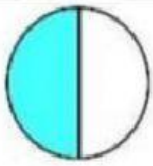	$\frac{1}{2}$ =	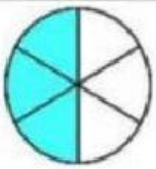	$\frac{\quad}{6}$	9)	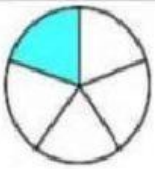	$\frac{\quad}{5}$ =	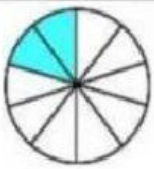	$\frac{\quad}{10}$
5)		$\frac{1}{3}$ =	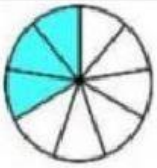	$\frac{\quad}{9}$	10)	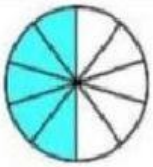	$\frac{\quad}{10}$ =	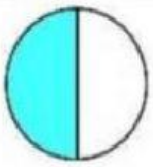	$\frac{\quad}{2}$

LIVEWORKSHEETS