Number Arrangement

1. Complete these. Count on in tens.

a.

b.

c.



d.



2. Complete these. Count on in fours.

a.

b.

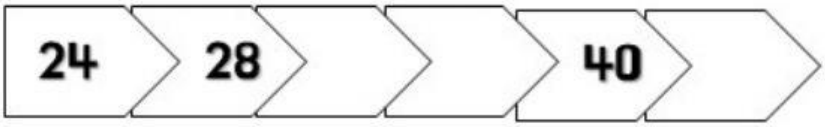

c.



d.

Cikgu iLi

LIVEWORKSHEETS