CEB RAFAEL PINEDA PONCE

MATEMATICAS

AREA Y PERIMETRO

SECCION "1" "2" "3"

DOCENTES TITULARES: ANA ROBLES, GISELA CÁRCAMO Y CARMEN REYES.

DOCENTES TUTORAS: NORMA BENITES Y ELIA PUERTO

FECHA: 27/Julio/2021

NOMBRE: _____

Área trapecio

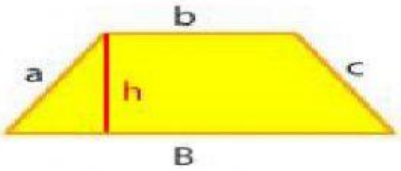

$$A = \frac{(B + b) \cdot h}{2}$$

Perímetro trapecio

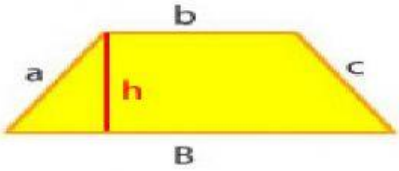

$$P = a + b + c + B$$

EJERCICIO: Calcule el área y perímetro del trapecio con las siguientes medidas en centímetros.

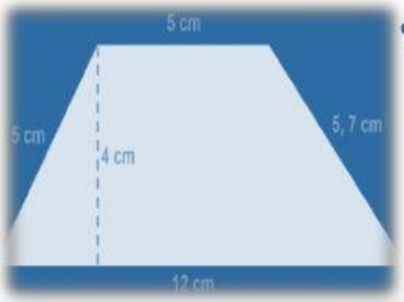

PERIMETRO

P = + + + =

ÁREA

A = (+) x = cm²

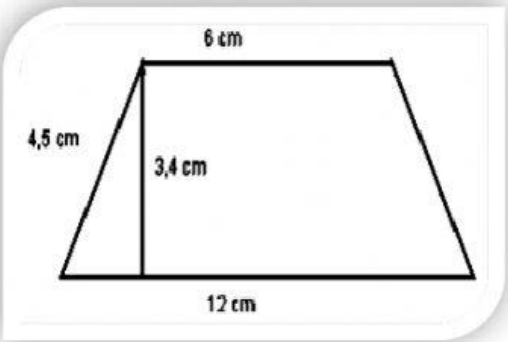

PERÍMETRO

P = + + + =

ÁREA

A = (+) x = cm²

LIVEWORKSHEETS