SOALAN STRUKTUR [4 MARKAH]

1. Nyatakan jenis servis putaran berdasarkan titik kontak pada bet pingpong dalam rajah di bawah.

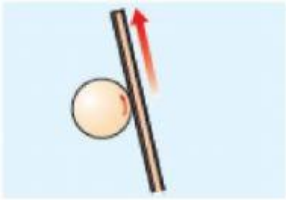	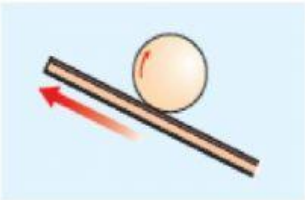	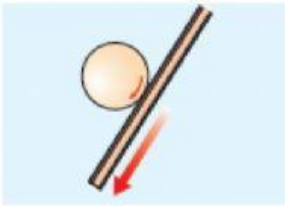	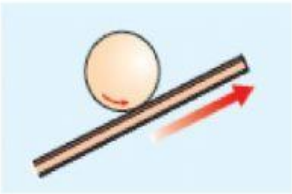
(a)	(b)	(c)	(d)

LIVEWORKSHEETS