CALCULAR EL PERIMETRO DE LAS SIGUIENTES FIGURAS PLANAS

1)Pentágono irregular

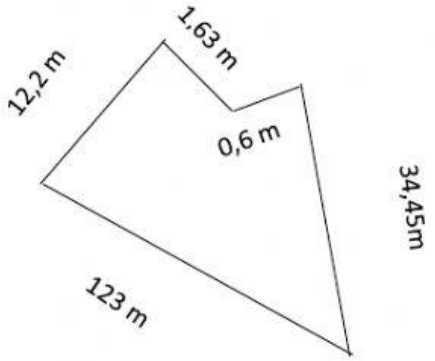

717,88m

171,88m

171,46m

2) Patio de la escuela



233,46m

466,72m

466,92m

3) Hexágono irregular

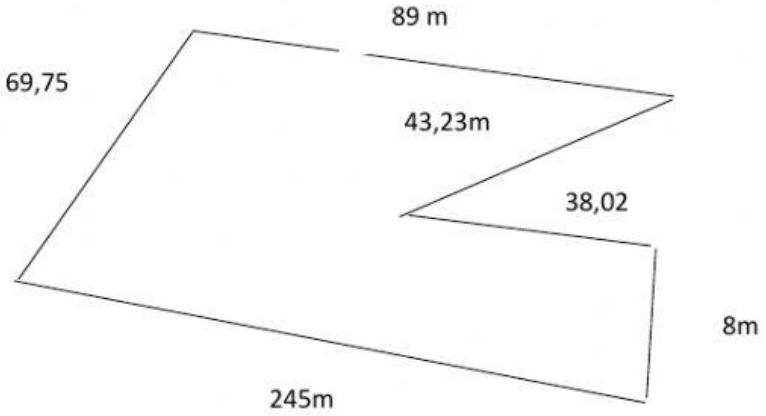

493,00

493,56

394,00

LIVEWORKSHEETS