Nama Penuh:

Sudut

3. Pada rajah di bawah ini, namakan sudut bagi setiap yang berikut.

a.

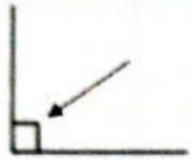

_____

b.

_____

c.

_____

d.

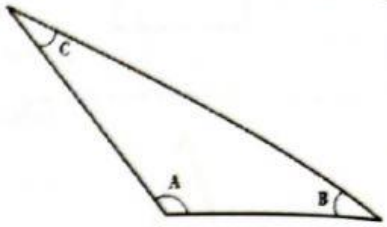

A. _____

B. _____

C. _____

Nilai Sudut

4. Rajah di bawah adalah protraktor.

a.

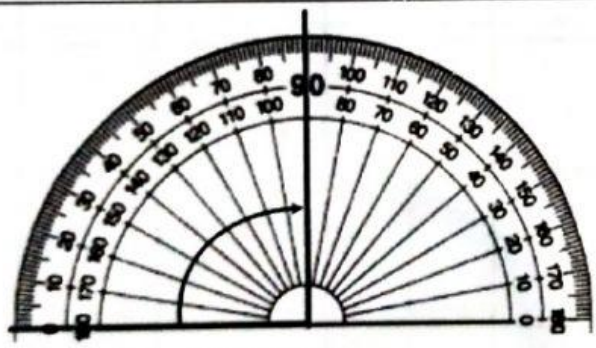

Berapakah nilai sudut itu?

_____

b.

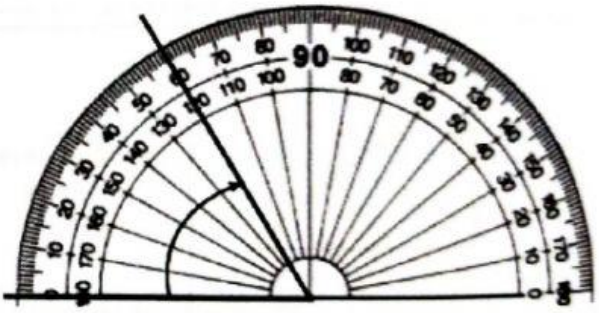

Berapakah nilai sudut itu?

_____

c.

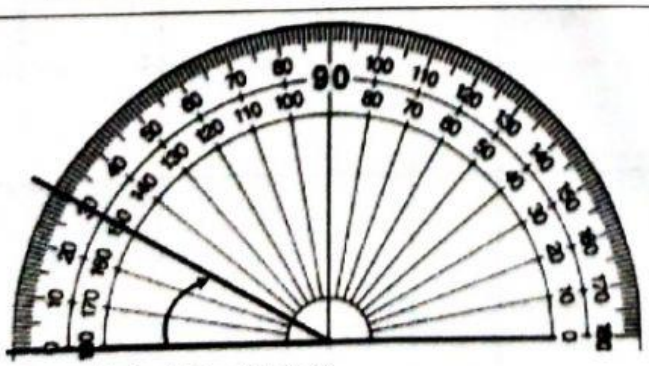

Berapakah nilai sudut itu?

_____

d.

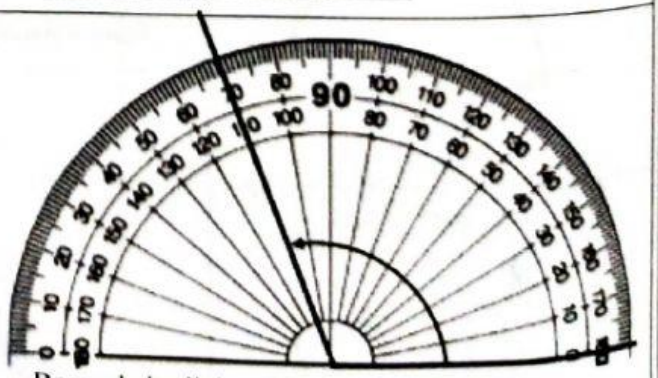

Berapakah nilai sudut itu?

_____

LIVEWORKSHEETS