1. Bulatkan objek ikut bentuk. Sebut namanya.

a.

bulatan



b.



segi empat



c.

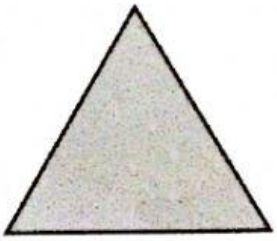

segi tiga

LIVEWORKSHEETS