Matematik Tahun 4 : Sudut (Latihan Buku Teks)

Disediakan oleh : Cikgu Wan Asmah

Nama :

Suaikan pada petak kosong dengan jawapan yang betul.

1 1 2 2 2 3 3 3 3

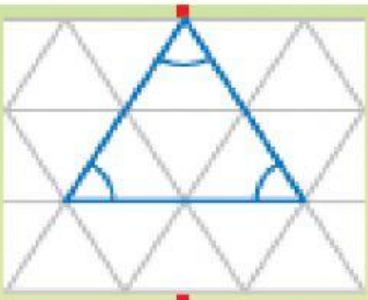

segi tiga sama sisi

- ☐ sudut tirus
- ☐ sisi sama panjang

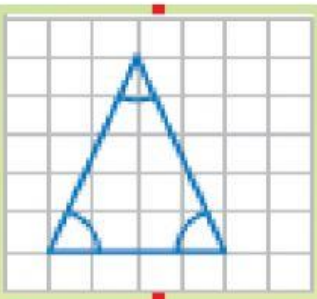

segi tiga sama kaki

- ☐ sudut tirus
- ☐ sisi sama panjang

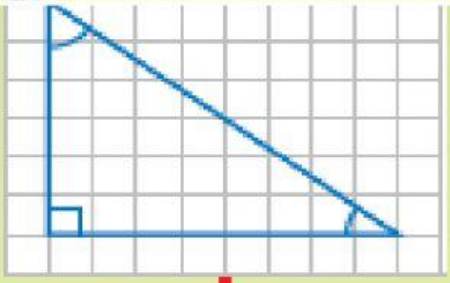

segi tiga bersudut tegak

- ☐ sudut tegak
- ☐ sudut tirus

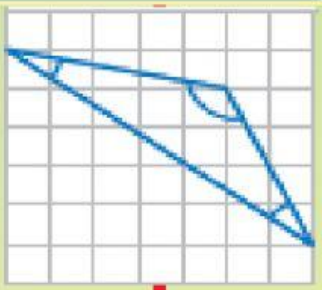

segi tiga tak sama kaki

- ☐ sudut cakah
- ☐ sudut tirus
- ☐ sisi tak sama panjang

LIVEWORKSHEETS

UJI DIRI

1 Label dan namakan sudut pada bentuk berikut.

Sudut tirus	Sudut tirus	Sudut tegak	Sudut tegak	Sudut tegak
Sudut tirus	Sudut tirus	Sudut tegak	Sudut tegak	Sudut cakah

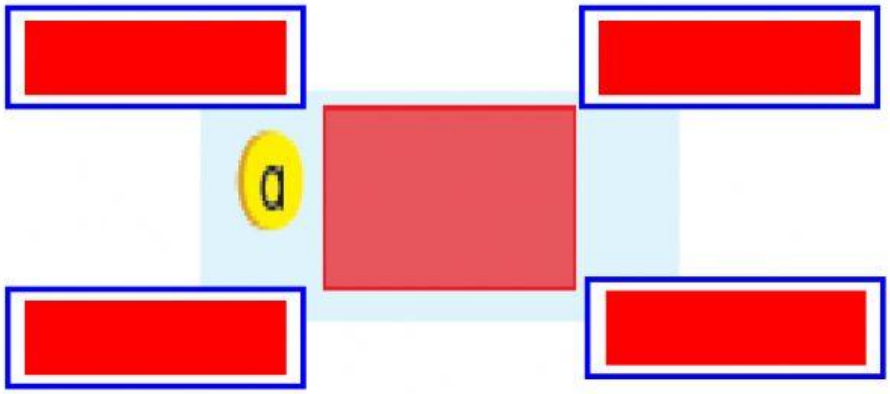



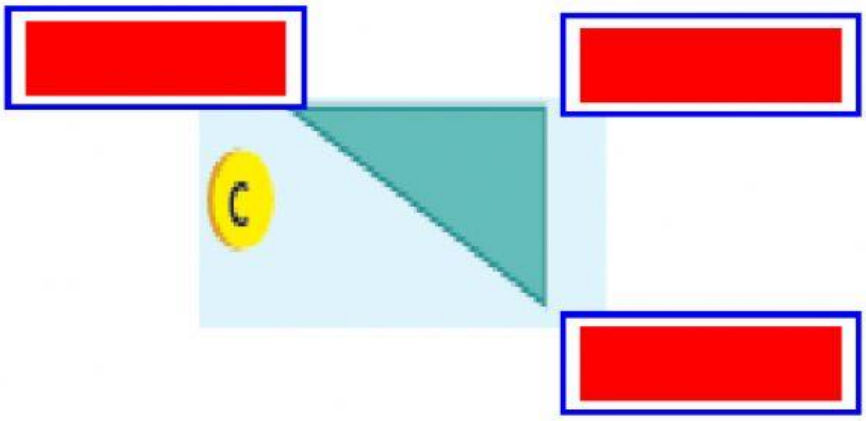

LIVEWORKSHEETS