QUIZ : ANGLES AND TANGENTS OF CIRCLE (FORM 3)

NAME :

CLASS :

1. In the diagram, PAQ is a tangent to a circle and ABCD is a cyclic quadrilateral

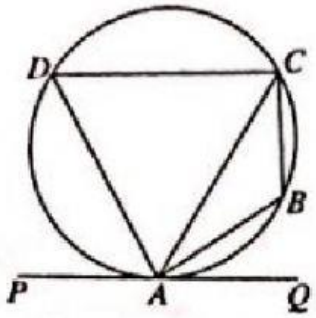

State whether the following statements is **TRUE** or **FALSE**

(i) $\angle BAQ = \angle ACB$

(ii) $\angle ADC + \angle BAC = 180°$

2. Fill in the blanks.

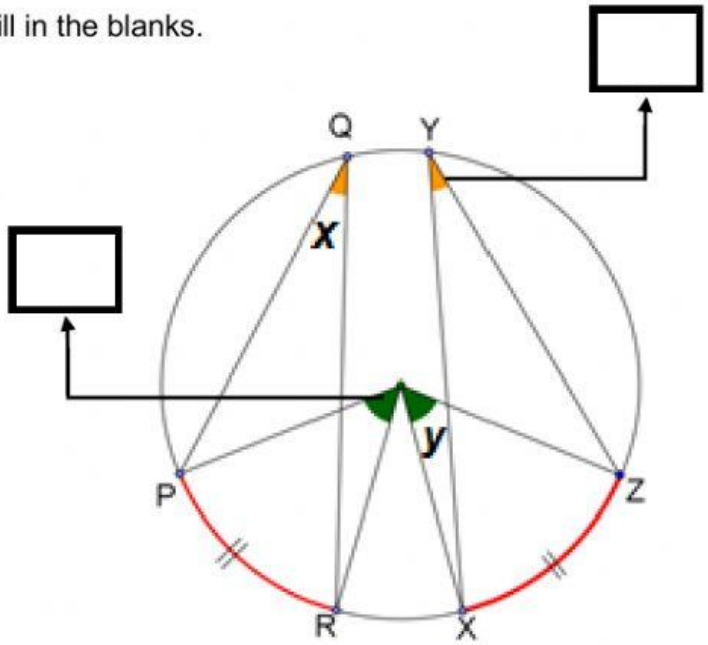

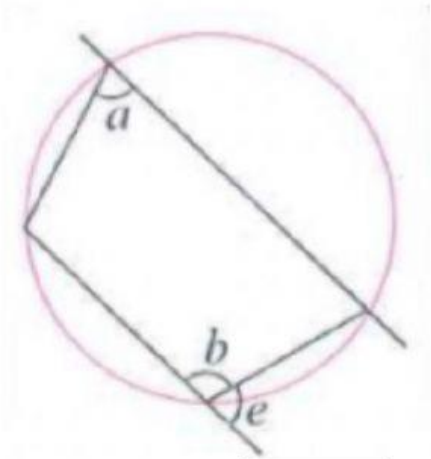

$\angle a = \angle$

LIVEWORKSHEETS

3. In the diagram, AC and BD are diameters of the circle.

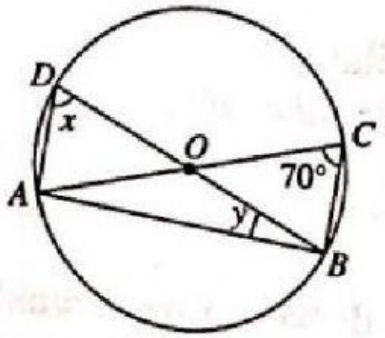

Find the values of *x* and *y*.

Answer : *(put value only without degree)*

$x° = \square$ $y° = \square$

4. In the diagram, PQRS is a cyclic quadrilateral and SPT is a straight line.

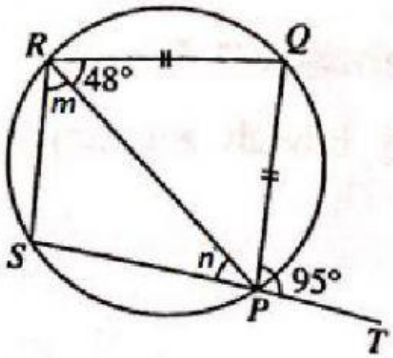

Given PQ=QR, find the values of *m* and *n*.

Answer : *(put value only without degree)*

$m° = \square$ $n° = \square$

5. In the diagram, RS and TPS are tangents to the circles. RS is parallel to QP.

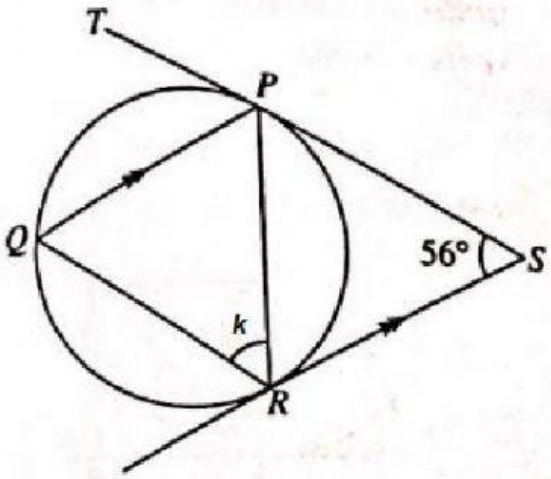

Find the values of *k*.

Answer : *(put value only without degree)*

$k° = \square$

LIVEWORKSHEETS