Measurement

Work out the area of the following rectangles.

1)



Area = _____ square cm

2)



Area = _____ square cm

3)

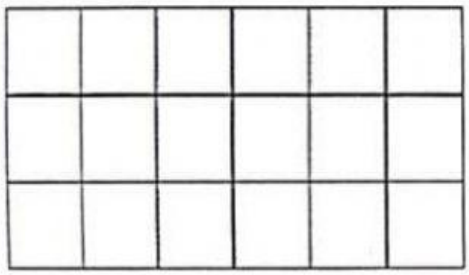

Area = _____ square cm

4)



Area = _____ square cm

5)

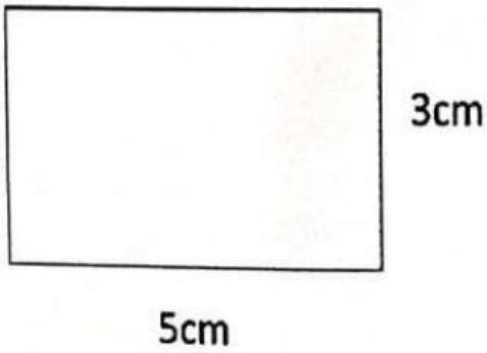

Area = _____ square cm

6)

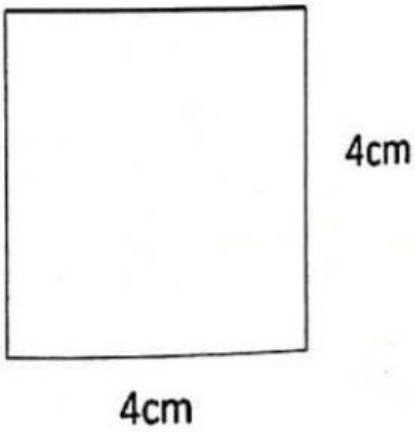

Area = _____ square cm

LIVEWORKSHEETS