Nama :

Arahan : Lengkapkan

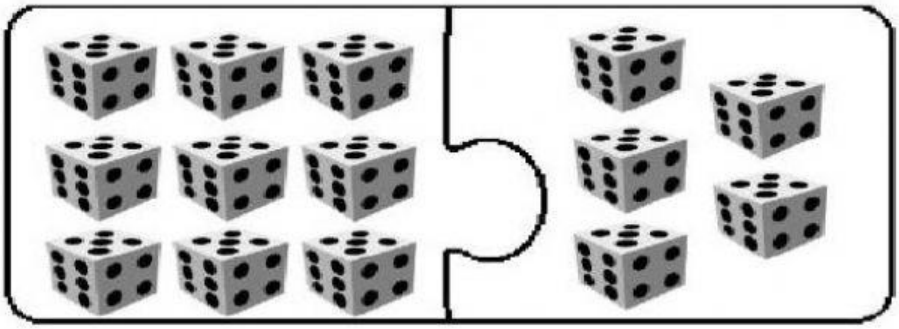

$9 + 5 = \square$

$$\begin{array}{r} 9 \\ + \quad 5 \\ \hline \\ \hline \end{array}$$

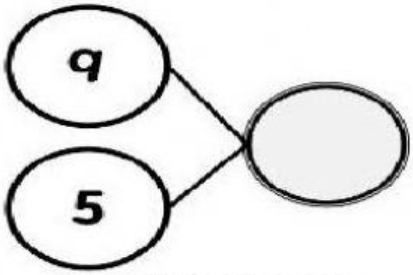



$6 + 6 = \square$

$$\begin{array}{r} 6 \\ + \quad 6 \\ \hline \\ \hline \end{array}$$

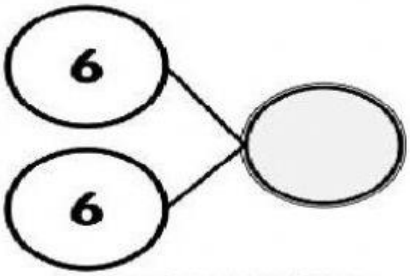

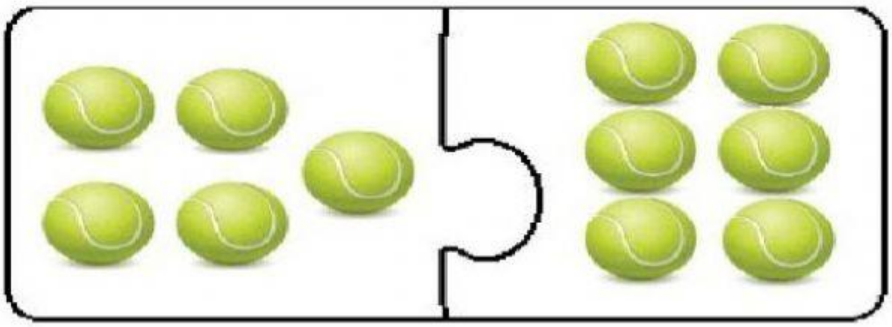

$5 + 6 = \square$

$$\begin{array}{r} 5 \\ + \quad 6 \\ \hline \\ \hline \end{array}$$



LIVEWORKSHEETS