NAMA : _____ TARIKH: _____

BANDINGKAN PERPULUHAN TERSEBUT. TULISKAN "LEBIH KECIL DARIPADA" ATAU "LEBIH BESAR DARIPADA".

1)

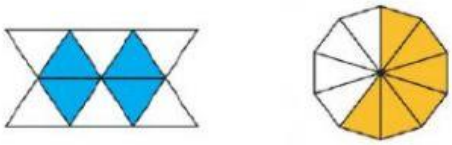

0.4 _____ 0. 6.

2)

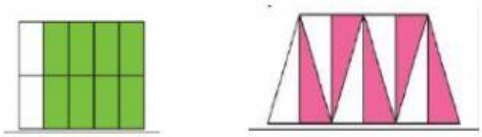

0.8 _____ 0.5.

3)

0.3 _____ 0.1.

LIVEWORKSHEETS

4)

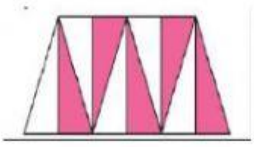

0.5 _____ 0.9.

5)

0.7 _____ 0.2.

6)

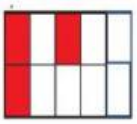

0.6 _____0.3.

LIVEWORKSHEETS