Wednesday, 30 June, 2021 9:00 AM

UJI MINDA 5.1d

3. Tentukan panjang sisi q untuk setiap segi tiga bersudut tegak berikut.

(a) $\sin \angle QRP = \frac{1}{3}$

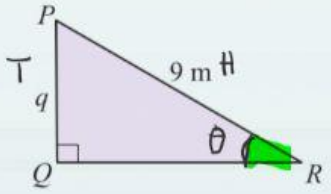

$\sin \theta = \frac{q}{\square} = \frac{1}{3}$

$q = \frac{1}{3} \times \square$

$q = \square$

(b) $\sin \angle LKM = \frac{7}{8}$

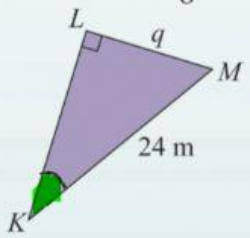

$\sin \theta = \frac{q}{\square} = \frac{\square}{\square}$

$q = \frac{\square}{\square} \times \square$

$q = \square$

(c) $\sin \angle ACB = \frac{2}{5}$

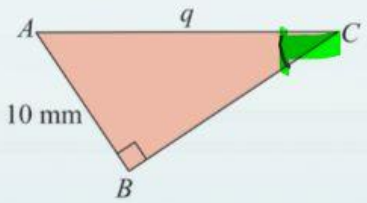

$\sin \theta = \frac{\square}{q} = \frac{\square}{\square}$

$q = \square \times \frac{\square}{\square}$

$q = \square$

LIVEWORKSHEETS