ÉXITO MATHS2.0
2021

INSTRUMEN 4

MoLeKuL
THINK IT EASY
(TIE)

TAHUN 6

Masa dan Waktu

KERTAS 1	/5
KERTAS 2	/20
JUMLAH	/25

UNIT SAINS DAN MATEMATIK
SEKTOR PEMBELAJARAN
JABATAN PENDIDIKAN WILAYAH PERSEKUTUAN KUALA LUMPUR

LIVEWORKSHEETS

KERTAS 2
***PAPER* 2**

Soalan 1(a)
Question 1(a)

Rajah 1 menunjukkan waktu pada suatu muka jam.
Diagram 1 *shows the time on a clock face.*

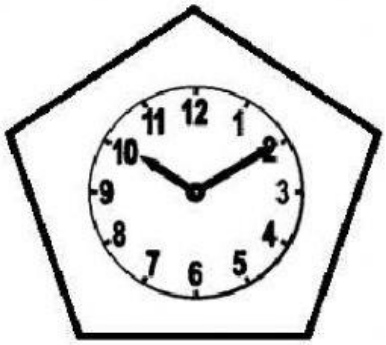

Rajah 1
Diagram 1

Nyatakan waktu pada muka jam itu.
State the time shown on the clock face.

	1 Markah 1 *Mark*

LIVEWORKSHEETS

Soalan 1(b)
Question 1(b)

Berikut menunjukkan waktu pada sebuah jam digital.
The following shows the time on a digital clock.

Tuliskan waktu itu dalam perkataan.
Write the time shown in words.

	1 Markah 1 *Mark*

LIVEWORKSHEETS

Soalan 2(a)
Question 2(a)

Rajah 2 menunjukkan waktu pada suatu permukaan jam.
Diagram 2 *shows the time on a clock face.*



Rajah 2
Diagram 2

Tukarkan waktu itu kepada sistem 24 jam.
Write the time shown in 24-*hour system.*

	1 Markah 1 *Mark*

LIVEWORKSHEETS

Soalan 2(b)
Question 2(b)

Jadual 1 menunjukkan waktu yang tidak lengkap.
Table 1 *shows an incomplete table.*

Sistem 12 jam **12-*hour system***	**Sistem 24 jam** **24-*hour system***
Pukul 12:40 p.m. 12:40 p.m.	
	Jam 1725 1725 *hours*

Jadual 1
Table 1

Lengkapkan jadual itu.
Complete the table.

2 Markah
2 *Marks*

LIVEWORKSHEETS

Soalan 3(a)
Question 3(a)

Berikut menunjukkan jadual yang tidak lengkap.
The following shows an incomplete table.

Program ***Programme***	**Waktu mula** ***Starting time***	**Waktu akhir** ***Ending time***	**Tempoh masa** ***Duration***
Teroka Makanan Seimbang ***Explore Balanced Meal***	8:15 a.m.	9:35 a.m.	
Tayangan Khas: Maafkan Saya Cikgu ***Special Broadcast: Forgive Me Teacher***	8:30 p.m.	11:15 p.m.	

Lengkapkan tempoh masa program pada jadual itu.
Complete the duration in the table above.

2 Markah
2 *Marks*

LIVEWORKSHEETS

Soalan 3(b)
Question 3(b)

Rajah 3 menunjukkan waktu pada muka jam di sebuah hotel.
Diagram 3 shows the time on a clock face in a hotel.



Rajah 3
Diagram 3

Lukis jarum jam dan jarum minit untuk menunjukkan waktu $\frac{1}{4}$ jam selepas waktu pada Rajah 3.

Draw the hour and minute hand to show $\frac{1}{4}$ *hours after the time shown in Diagram* 3.

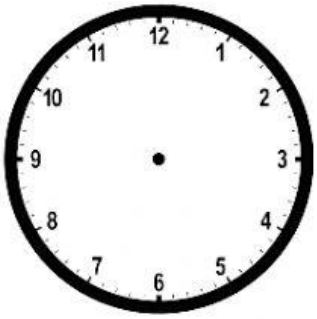

	3 Markah 3 *Marks*

LIVEWORKSHEETS

Soalan 4(a)
Question 4(a)

Rajah 4 menunjukkan waktu Imran bertolak ke sekolah pada waktu pagi untuk menghadiri latihan bola sepak.
Diagram 4 shows the time Imran set off in the morning to school for soccer practice.

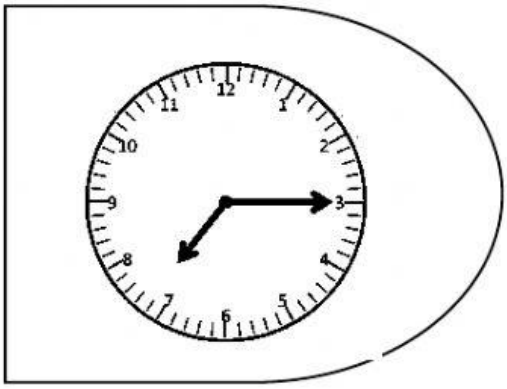

Rajah 4
Diagram 4

i. Nyatakan waktu itu dalam sistem 12 jam.
State the time above in 12-*hour system.*

ii. Perjalanan Imran ke sekolah mengambil tempoh masa $\frac{1}{2}$ jam.
Imran's journey to school takes $\frac{1}{2}$ *hours.*

Pukul berapakah dia sampai?
What time did he arrive?

	2 Markah 2 *Marks*

LIVEWORKSHEETS

Soalan 4(b)
Question 4(b)

Berikut menunjukkan perbualan antara Razak dan Malina.
The following shows a conversation between Razak and Malina.

Semalam saya sampai rumah pada pukul 3.15 petang.

Yesterday I arrived home at 3:15 in the evening.

Oh ye ke! Saya pula sampai rumah 20 minit sebelum awak.

Oh, is it! I arrived home 20 *minutes before you.*

Razak Malina

i) Pukul berapakah Malina sampai ke rumahnya?
What time did Malina arrived home?

ii) Suaikan waktu yang betul.
Match the right time.

3:15 p.m.

Jam 1515
1515 *hours*

Jam 0315
0315 *hours*

Jam 3015
3015 *hours*

3 Markah
3 *Marks*

LIVEWORKSHEETS