UNIDAD EDUCATIVA PARTICULAR

"Master Zoila"

Nombre: _____ *Grado: Tercero "A"*

Profesor: Adriana Alvarado T. *Fecha:* _____

LECCIÓN #1 DE MATEMÁTICA

1. *ESCRIBE SI ES PRISMA O PIRÁMIDE Y ESCRIBE SUS PARTES.*

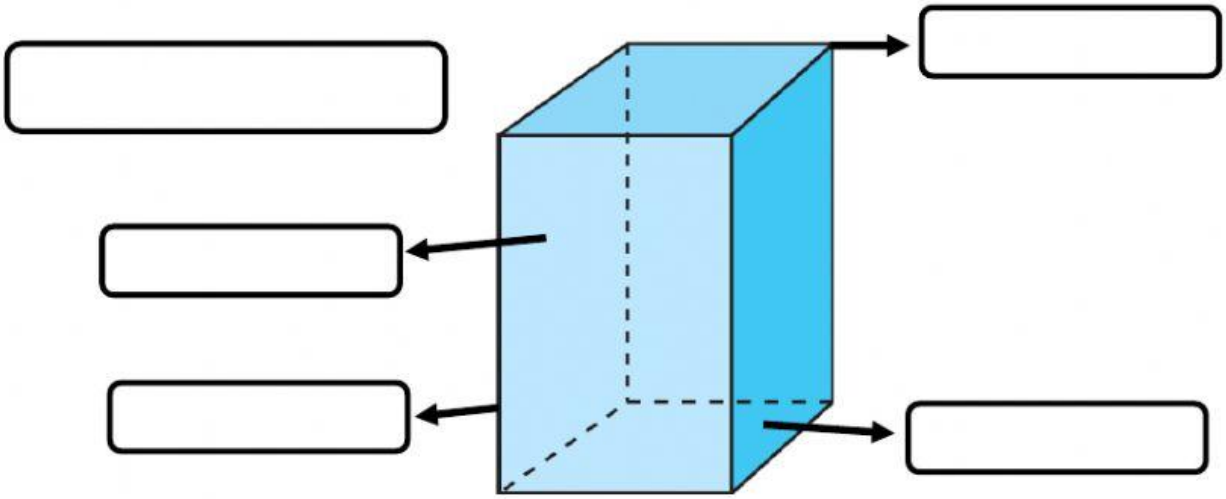

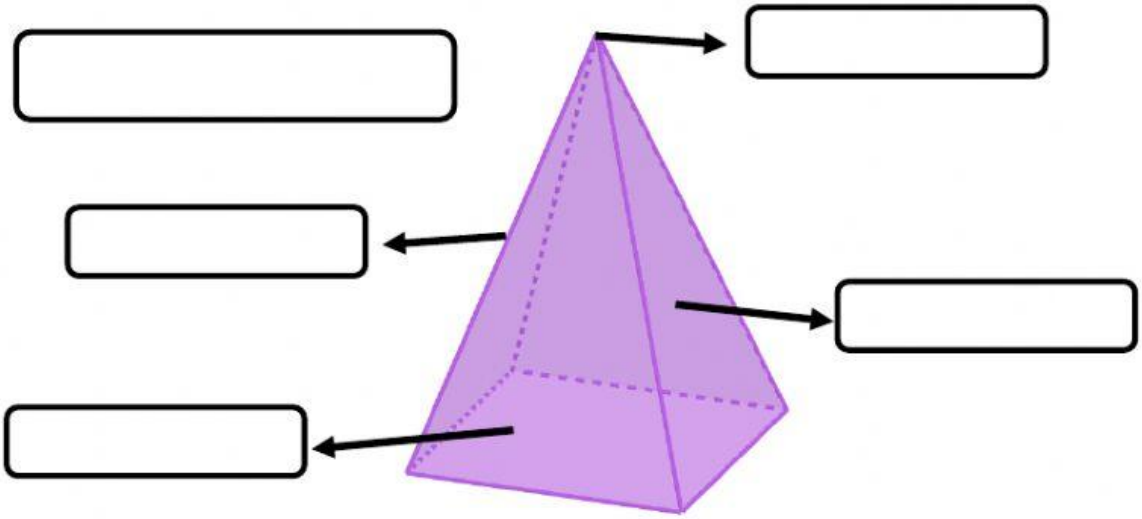

LIVEWORKSHEETS

2. **ARRASTRA EN QUE LUGAR VA CADA COMPETIDOR EN LA MARATÓN.**

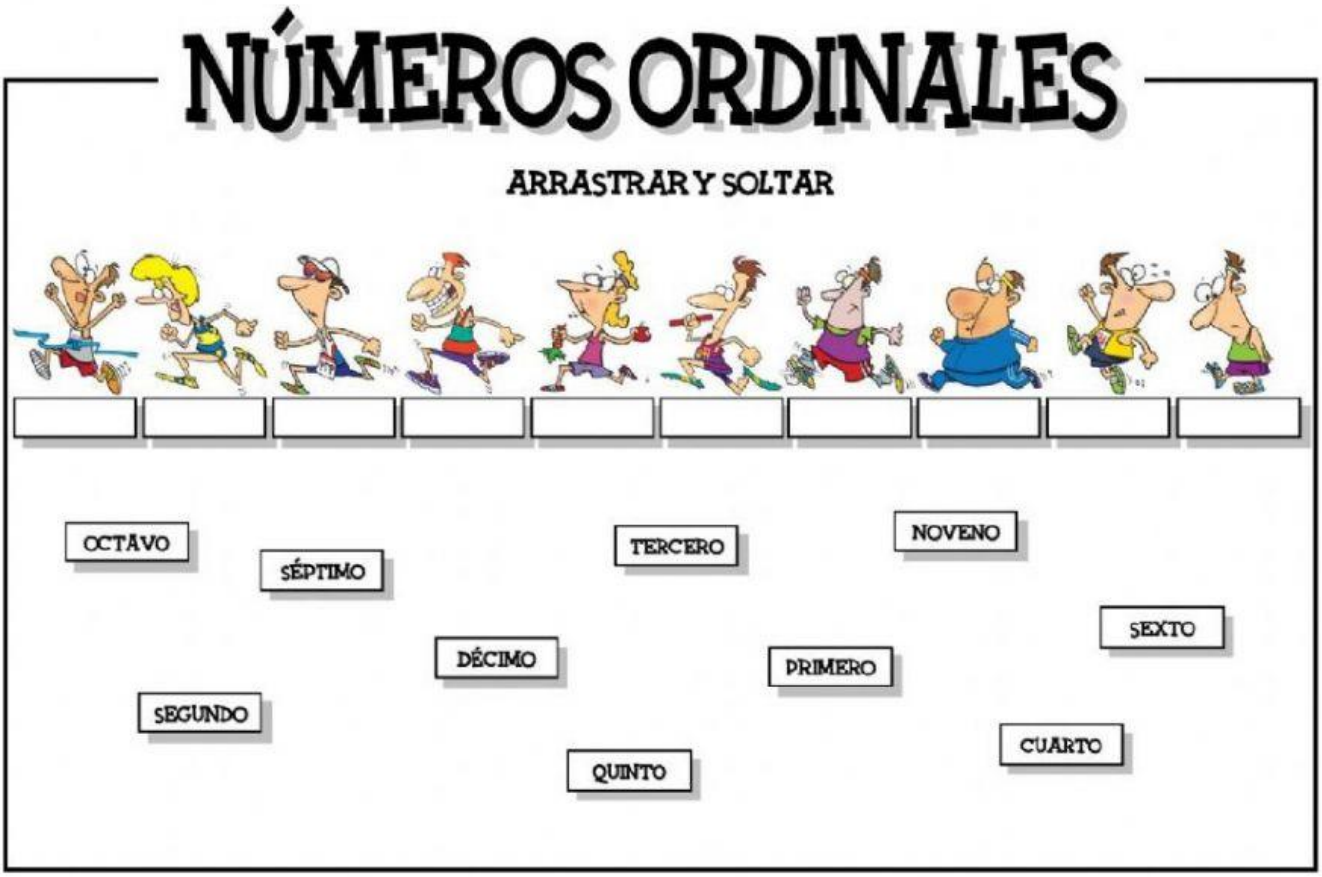

3. **RESUELVE LAS SUMAS.**

$$\begin{array}{r} 824 \\ +\ 121 \\ \hline \end{array} \qquad \begin{array}{r} 438 \\ +\ 141 \\ \hline \end{array} \qquad \begin{array}{r} 722 \\ +\ 276 \\ \hline \end{array} \qquad \begin{array}{r} 174 \\ +\ 414 \\ \hline \end{array}$$

$$\begin{array}{r} 372 \\ +\ 326 \\ \hline \end{array} \qquad \begin{array}{r} 362 \\ +\ 337 \\ \hline \end{array} \qquad \begin{array}{r} 265 \\ +\ 231 \\ \hline \end{array} \qquad \begin{array}{r} 512 \\ +\ 166 \\ \hline \end{array}$$

LIVEWORKSHEETS

4. RESUELVE LAS RESTAS.

786	369	329	146
- 485	- 233	- 328	- 101
536	731	854	598
- 202	- 301	- 143	- 136

LIVEWORKSHEETS