5.1 Sinus, Kosinus dan Tangen bagi Sudut Tirus dalam Segi Tiga Bersudut Tegak

Latihan Ulang kaji Bab 5 Nisbah Trigonometri

1. Dalam segi tiga bersudut tegak, kenal pasti hipotenus, sisi bertentangan , sisi bersebelahan berdasarkan sudut tirus ɵ yang diberi.

	Segi tiga bersudut tegak	Hipotenus	Sisi bertentangan	Sisi bersebelahan
a	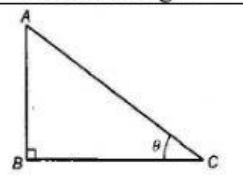			
b	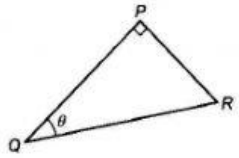			
c	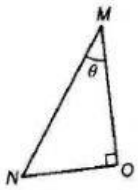			
d	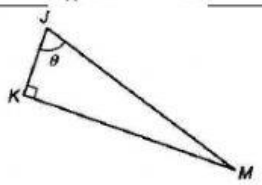			

Teorem Pythagoras $c^2 = a^2 + b^2$

2. Cari panjang sisi yang satu lagi dengan menggunakan Teorem Pythagoras.

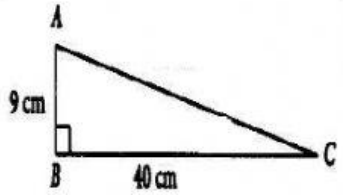

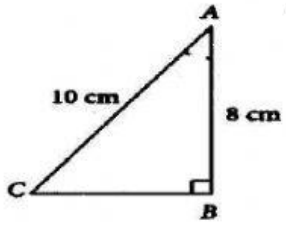

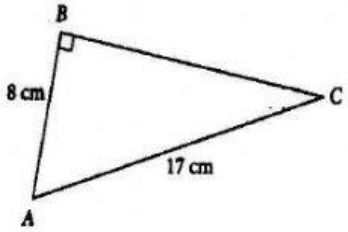

LIVEWORKSHEETS

LIVEWORKSHEETS