PEPERIKSAAN PENILAIAN PRESTASI
PENDIDIKAN KHAS
TAHUN 2021

MATA PELAJARAN : MATEMATIK

TARIKH : 30 JUN 2021

HARI : RABU

NAMA MURID :

NAMA KELAS :

ARAHAN

1. This question paper consist of a few part.
   Kertas soalan ini mengandungi beberapa bahagian

2. Answer all questions
   Jawab semua soalan

LIVEWORKSHEETS

Padankan nombor mengikut bilangan objek yang betul.

3	5	1
6	2	7

LIVEWORKSHEETS







LIVEWORKSHEETS

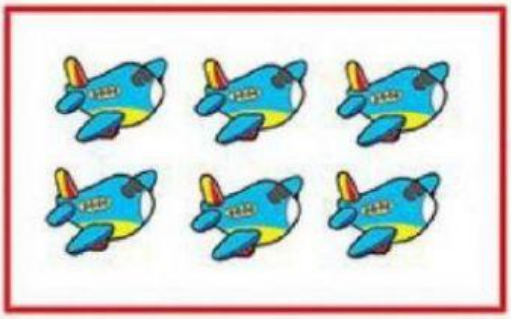

9

4



6

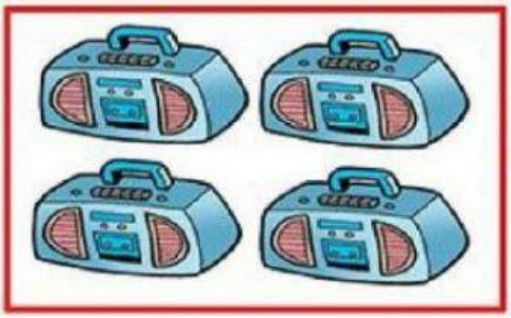

3

LIVEWORKSHEETS

Lengkapkan nombor pada jam.

1	2	3	4	5	6
7	8	9	10	11	12

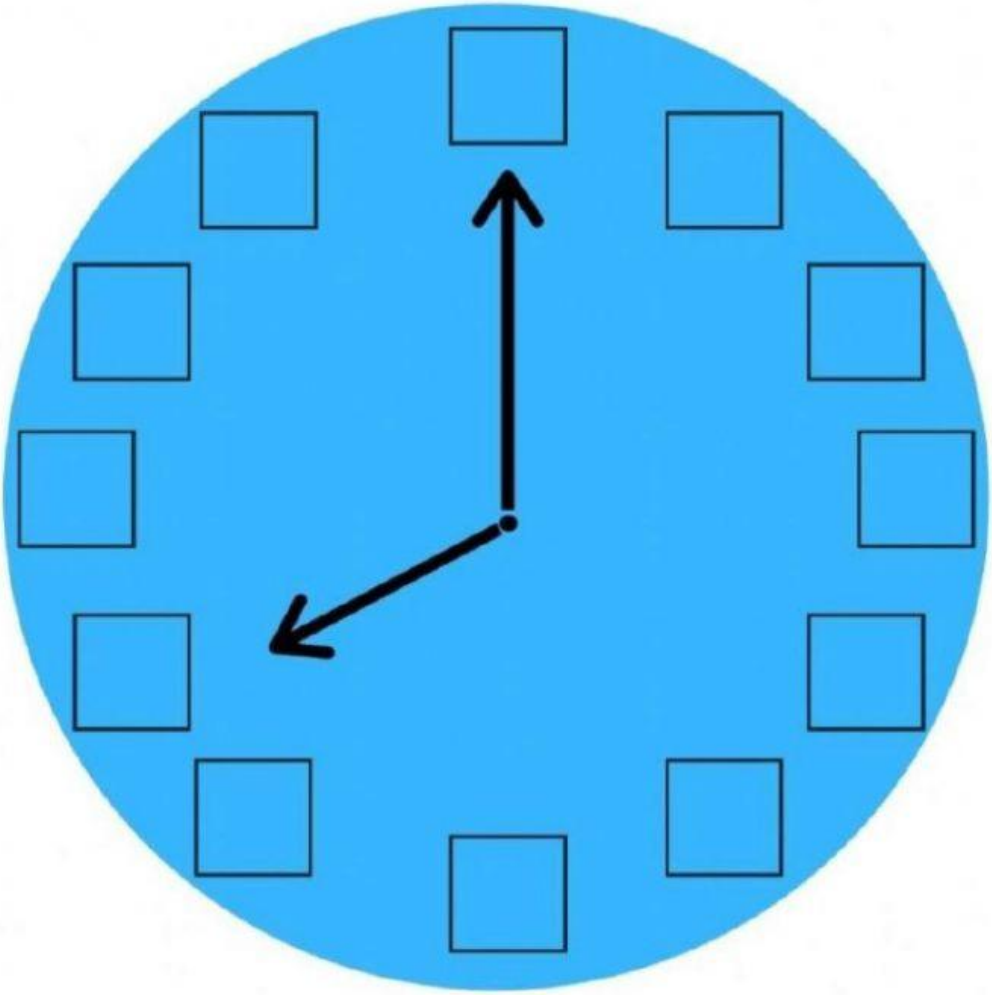

LIVEWORKSHEETS

LIVEWORKSHEETS

Padankan bilangan dengan nombor.







15

11

13

LIVEWORKSHEETS

Tajuk : Nombor

	15	dua puluh
1.	18	lapan belas
2.	11	lima belas
3.	17	empat belas
4.	13	dua belas
5.	19	sembilan belas
6.	14	tujuh belas
7.	12	enam belas
8.	20	tiga belas
q.	16	sebelas

LIVEWORKSHEETS

Lengkapkan tempat kosong dengan nombor yang betul:

1	2	3		5	6			9	10
	12	13	14	15		17	18	19	
21		23		25	26	27		29	30
	32		34	35		37	38		40
41	42	43	44		46		48	49	50
51			54	55	56	57		59	
	62	63	64		66		68		70
71	72		74	75		77	78	79	
81		83		85	86	87		89	90
91	92		94	95		97	98		100

LIVEWORKSHEETS