# Fluency Challenge 1

Calculate the volume

1) Cube of side length 3 cm

2) Cube of side length 4 cm

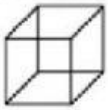

3) Cube of side length 1 cm

4) Cube of side length 1.5 cm

Calculate the volume

1)

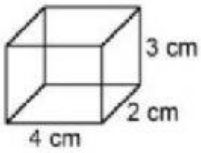


2)

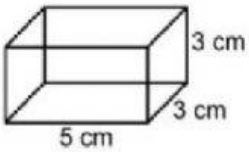


3)

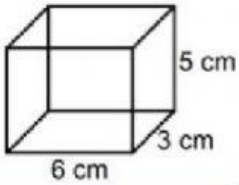


Find x

1) Volume = 20 $cm^3$

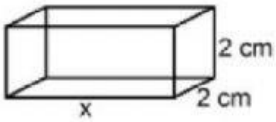


2) Volume = 36 $cm^3$

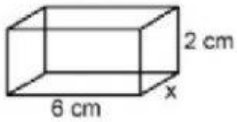


3) Volume = 120 $cm^3$

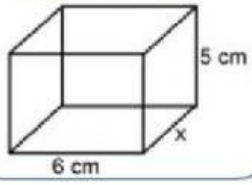


LIVEWORKSHEETS