NAMA :

SEBUTKAN PECAHAN WAJAR DIBAWAH

1) $\frac{1}{3}$ =

2) $\frac{3}{4}$ =

3) $\frac{5}{7}$ =

4) $\frac{4}{8}$ =

5) $\frac{8}{9}$ =

6) $\frac{7}{10}$ =

7) $\frac{1}{5}$ =

8) $\frac{2}{7}$ =

9) $\frac{4}{9}$ =

10) $\frac{3}{6}$ =

11) 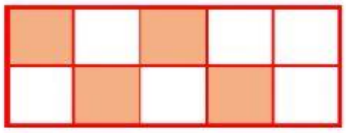 = $\frac{\square}{\square}$

12) = $\frac{\square}{\square}$

13) 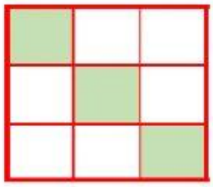 = $\frac{\square}{\square}$

14)  = $\frac{\square}{\square}$

15)  = $\frac{\square}{\square}$

16) = $\frac{\square}{\square}$

17)  = $\frac{\square}{\square}$

18)  = $\frac{\square}{\square}$

19)  = $\frac{\square}{\square}$

20) = $\square$

LIVEWORKSHEETS