TRABAJANDO CON LAS FIGURAS GEOMÉTRICAS

LLEVA LAS FIGUARAS HACIA SU NOMBRE

TRIÁNGULO

CIRCULO

RECTÁNGULO

CUADRADO

LIVEWORKSHEETS

CALCULANDO PERÍMETROS DE FIGURAS GEOMÉTRICAS BÁSICAS

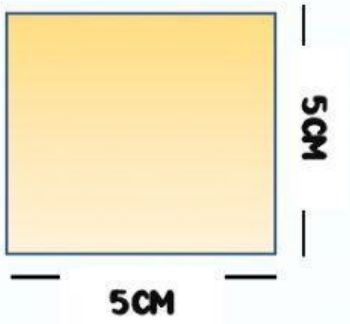

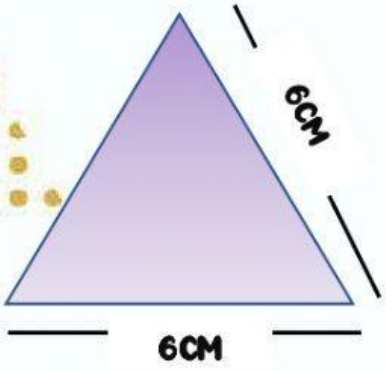

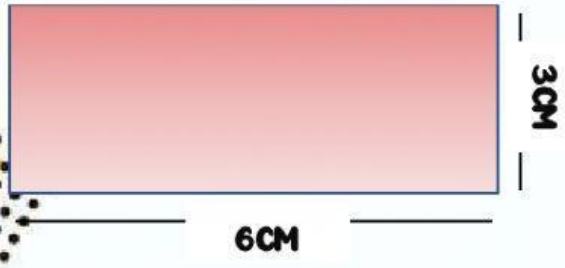

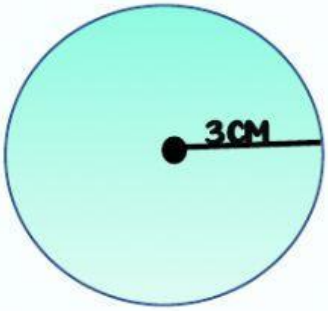

LIVEWORKSHEETS

¿CUÁNTOS LADOS TIENE CADA FIGURA?

LIVEWORKSHEETS